डी बी जे. महाविद्यालय, चिपळूण
वार्षिक परीक्षा २०१९
विषय : हिंदी
कक्षा ग्यारहवी (विज्ञान / वाणिज्य)

समय: ३ घटे कुल अंक ८०

प्र १) अ) निम्नलिखित परिच्छेद पढकर सूचनाओं के अनुसार कृतियां कीजिए। (८)

१) सजाल पूर्ण किजिए। (२)

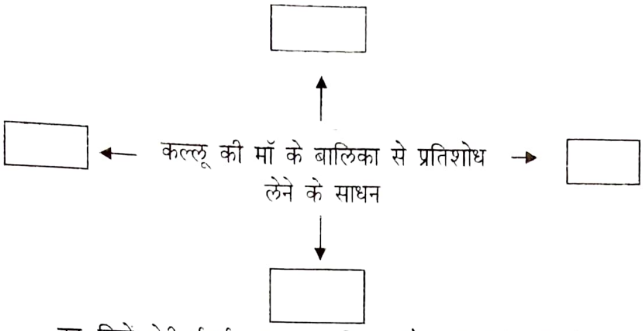

उन दिनों मेरी ईर्ष्या का मुख्य विषय नौकरानी की लडकी थी, जिसे चौका–बर्तन करके घर में रहने को तो मिला जाता था. जिस कठोर ईश्वर ने मेरे भाग्य में नित्य स्कूल जाना लिख दिया था, वह मॉ के ठाकुर जी में से कोई है या मिशन की सिस्टर का ईसू, यह निश्चय न कर सकने के कारण मेरा मन विचित्र दुविधा में पडा रहता था। यदि वह मॉ के ठाकुर जी में से है, तो आरती–पूजा से जी चुराते ही क्रुध्द होकर मेरे घर रहने का समय और कम कर देगा और यदि स्कूल में है, तो बहाना बनाकर न जाने से पढाई के घटे और बढा देगा, इसी उधेड–बुन में मेरा मन पूजा, आरती, प्रार्थना सब में भटकता ही रहता था।

इस अंधकार में प्रकाश की एक रेखा भी थी। स्कूल निकट होने के कारण बूढी कल्लू की मॉ मुझे किताबों के साथ वहॉ पहुँचा भी आती थी और ले भी जाती थी और इस आवागमन के बीच में, कभी सडक पर लडते हुए कुत्ते, कभी उनके भटकते हुए पिल्ले, कभी किसी कोने में बैठ कर पंजों से मुँह धोती हुई बिल्ली, कभी किसी घर मे बरामदे में लटकते हुए पिंजडे में मनुष्य की स्वर–साधना करता हुआ गंगाराम, कभी बत्तख और तीतरों के झुंड, कभी तमाशा दिखलानेवालों के टोपी लगाए हुए बंदर, ओढनी ओढे हुए बंदरीया, नाचनेवाला रीछ आदि स्कूल की एकरसता दूर करते ही रहते थे।

हमारे उँचे घर से कुछ ही हटकर, एक ओर रंगीन, सफेद, रेशमी और सूती कपडों से और दूसरी ओर चमचमाते हुए पीतल के बर्तनों से सजी हुई एक नीची–सी दूकान में जो वृध्द सेठजी बैठते रहते थे, उन्हें तो मैने कभी ठीक से देखा ही नहीं; पर उस घर के पीछे वाले द्वार पर पडे हुए पुराने टाट के परदे के छेद से जो ऑखें प्राय: मुझे आते– जाते देखती रहती थीं, उनके प्रति मेरा मन एक कुतूहल से भरने लगा। कभी–कभी मन में आता था कि परदे के भीतर झॉक कर देखूँ; पर कल्लू की मॉ मेरे लिए उस जंतुविशेष से कम नहीं थी, जिसकी बात कह–कह कर बच्चों को डराया जाते है। उसका कहना न मानने से वह नहलाते समय मेरे हाल ही में छिदे कान की लौ दुखा सकती थी, चोटी बॉधते समय बालों को खूब खींच सकती थी, कपडे पहनाते समय तंग गलेवाले

आणि माणसांच्या चाहुलीनं त्याला चैतन्य आलंय. दळणवळणाच्या साधनांनी हेमलकसा आणि बाकीचं जग यात एक पूल बांधला गेलाय. हा सगळा प्रवास 'अंधाराकडून उजेडाकडे' असा होता.

१. तुम्हाला माहीत असलेल्या एका समाजसुधारकाची माहिती ८ ते १० ओळीत तुमच्या शब्दांत लिहा. (०२)

किंवा

लोकविरादारी प्रकल्प सुरू झाल्यानंतर झालेल्या सुधारणा उताऱ्याच्या आधारे ८ ते १० ओळीत तुमच्या शब्दांत लिहा.

फ्राक की आंखों पर अटका सकती थी, घर में और स्कूल में मेरी बहुत सी झूठी सच्ची शिकायत कर सकती थी, सारांश यह कि उसके पास प्रतिशोध लेने बहुत से साधन थे।

२) कृती पूर्ण कीजिए (२)

पाठशाला के रास्ते में बालिका के आकर्षण

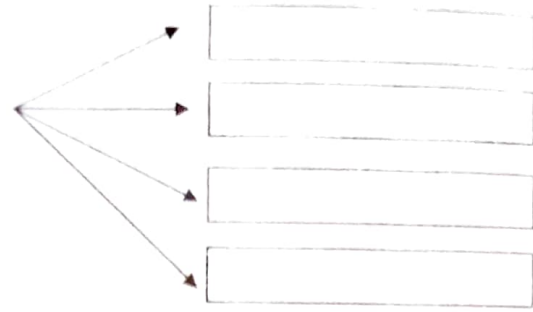

३) निम्नलिखित शब्दों के विलोम (विरूध्दार्थी) शब्द लिखिए। (२)

१) निकट २) प्रकाश ३) कठोर ४) झुठी

४) विधवा की स्थिती का ६–८ पंक्तियो मे वर्णन कीजिए। २

आ) निम्नलिखित परिच्छेद पढकर सुचनाओं के अनुसार कृतीयॉ कीजिए। (८)

१) संजाल पूर्ण कीजिए। २

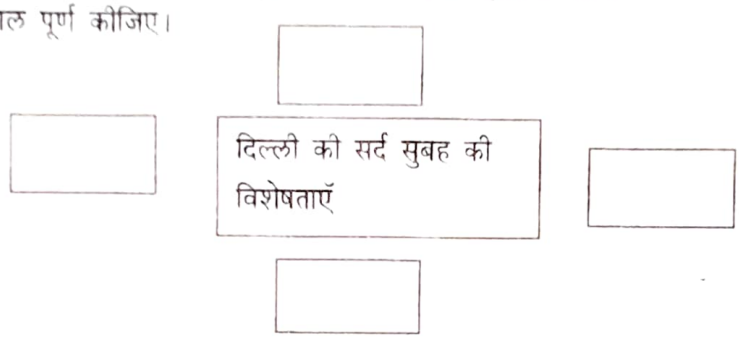

चारो तरफ कुहरा छाया हुआ है। सुबह के नौ बज चुके हैं, लेकिन पूरी दिल्ली धुंद में लिपटी हुई है। सडकें नम है। पेड भीगे हुए है। कुछ भी साफ नहीं दिखाई देता। जिंदगी की हलचल का पता आवाजोंसे लग रहा है। ये आवाजें कानों में बस गई है। घर के हर हिस्से से आवाजें आ रही है। वासवानी के नौकर ने रोज की तरह स्टोव जला लिया हैं, उसकी सनसनाहट दीवार के उस पार से आ रही है। बगल वाले कमरे में अतुल मवानी जूते पर पालिश कर रहा है – ऊपर सरदार जी मूँछों पर फिक्सो लगा रहे है – उपकी खिडकी के परदे के पार जलता हुआ बल्प बडे मोती की तरह चमक रहा है। सब दरवाजे बंद है, सब खिडकियों पर परदे हैं, लेकिन हर हिस्से में जिंदगी की खनक है। तिमंजिले पर वासवानी ने बाथरूम का दरवाजा बंद किया है। और पाइप खोल दिया है।

कुहरे में बसें दौड रही हैं। जूँ–जूँ करते भारी टायरों की आवाजें दूर से नजदीक आती हैं और फिर दूर हो जाती हैं। मोटर–रिक्शे बेतहाशा भागे चले जा रहे हैं। टैक्सी का मीटर अभी किसी ने डाउन किया है। पडोस के डॉक्टर के यहॉ फोन की घंटी बज रही है और पिछवाडे गली से गुजरती हुई कुछ लडकियॉ सुबह की श्फ्ट पर जा रही हैं।

सख्त सर्दी है। सडकें ठिठुरी हुई हैं और कोहरे के बदलों को चीरती हुई कारें और बसें हार्न बजाती हुई भाग रही हैं। सडकों और पटरियों पर भीड है,

पर कुहरे में लिपटा हुआ हर आदमी भटकती हुई रूह की तरह लग रहा है।

वे रूहें चुपचाप धुंद के समुद्र में बढती जा रही हैं, – बसों में भीड है। लोग ठडी सीटों पर सिकुडे बैठे है और कुछ लोग बीच में लटके हुए है – बाँहे पसारे, उनकी हथेलियों में बस की बर्फीली चमकदार छडे है।

और ऐसे में दूर से एक अरथी सडक पर चली आ रही है

इस अरथी की खबर अखबार में है। मैंने अभी–अभी पढी है। इसी मौत की खबर होगी। अखबार मे छपा है – आज राज करोलबाग के मशहूर और लोकप्रिय बिजनेस मैगनेट सेठ दीवानचंद की मौत इरविन अस्पताल में हो गई। उनका शव कोठी पर ले आया गया है। कल सुबह नौ बजे उनकी अरथी आर्यसमाज रोड से होती हुई पॅचकुइयाँ भूमी में दाहसंस्कार के लिए जाएगी।

२) निम्नलिखित शब्द और विशेषण की जोडी बनाइए।
सडके, भीगे, पेड, सख्त, चाल, सर्दी, धीमी, नम

१) ☐ → ☐

२) ☐ → ☐

३) ☐ → ☐

४) ☐ → ☐

३) निम्नलिखित का एक शब्द में उत्तर लिखिए। २

१) सरदार जी मुँछों पर लगाते है

२) मरनेवाले मशहूर तथा धनाढय व्यक्ति का नाम

३) अतुल मवानी कर रहा है

४) श्मशान–भूमी का नाम

४) आज 'मनुष्य–मनुष्य के बीच दूरी पैदा हो रही है' इस विषय अपने विचार स्पष्ट कीजिए। (६–८ पंक्तियों मे) २

इ) निम्नलिखित प्रश्नों मे से किसी एक प्रश्न का उत्तर लगभग ८०–१०० शब्दों मे लिखिए। ४

१) छुसरे साल लाजो ने करवा का व्रत किस प्रकार रखा?

२) लेखिका के भाई ने पत्र में क्या लिखा था?

३) शंतनूराव किन उपाधियों से सम्मानित हुए और क्यों?

प्र. २) अ) निम्नलिखित पदयांश पढकर सूचनाओंके अनुसार कृतियाँ किजिए। ६

संजाल पूर्ण किजिए।

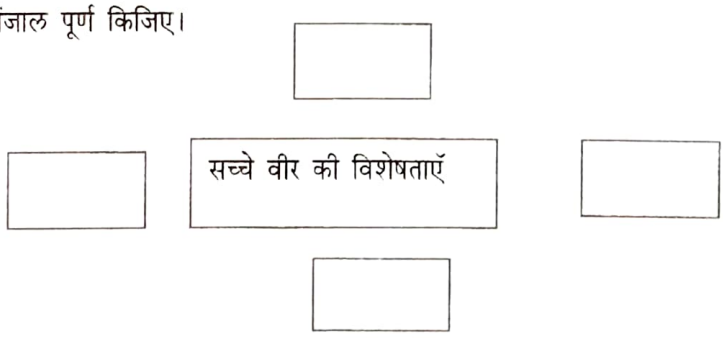

सच है, विपत्ति जब आती है,
कायर को ही दहलाती है,
सूरमा नहीं विचलित होते,
क्षण एक नहीं धीरज खोते
विघ्नों को गले लगाते है,
काँटों में राह बनाते है।
मुख से न कभी उफ कहते हैं,
संकट का चरण न गहते हैं,
उदयोग–निरत नित रहते हैं,
शूलों का मूल नशाने को,
बढ खुद विपत्ति पर छाने का।
है कौन विघ्न ऐसा जग मे
टिक सके आदमी के मग में?
खम ठोंक ठेलता है जब नर,
पर्वत के जाते पाँव उखड।

२) वाक्य पूर्ण कीजिए। २

१ सच हे विपत्ति जब आती है
कायर कौ ही .....

२) विघ्नों को गले लगाते हैं
काटों में .....

३) सच्चा वीर कविता का संदेश संक्षेप में लिखिए। २

आ) निम्नलिखित पद्यांश पढकर सुचनाओं के अनुसार कृतियाँ कीजिए। ६

१) संजाल पूर्ण कीजिए।

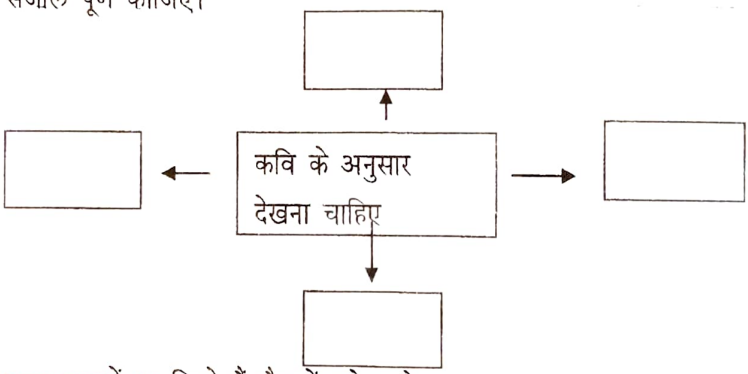

आज सडकों पर लिखे हैं सैकडों नारे न देख,
घर अँधेरा देख तू, आकाश के तारे न देख।
एक दरिया है यहाँ पर दूर तर फैला हुआ,
आज अपने बाजुओं को देख, पतवारें न देख।
अब यकीनन ठोस है धरती हकीकत की तरह,
यह हकिकत देख लेकिन खैफ के मारे न देख।
वे सहारे भी नहीं अब, जंग लडनी है तुझे,
कट चुके जो हाथ, उन हाथों में तलवार न देख।
दिल तो बहला ले, इजाजत है, मगर इतना न उड।
रोज सपने देख, लेकिन इस कदर प्यारे न देख।
ये धुँधलका है नजर का, तू महज मायूस है,

रोजनों को देख, दीवारों में दीवारें न देख।

२) तलिका पूर्ण कीजिए। २

कवि के अनुसार ये नही देखना चाहिए –

१)	
२)	
३)	
४)	

३) इस गजल के द्वारा कवि क्या प्रेरणा देते है? २

इ) निम्नलिखित पद्यांश पढकर सुचनाओं के अनुसार कृतियॉ कीजिए ४

सजाल पूर्ण कीजिए। २

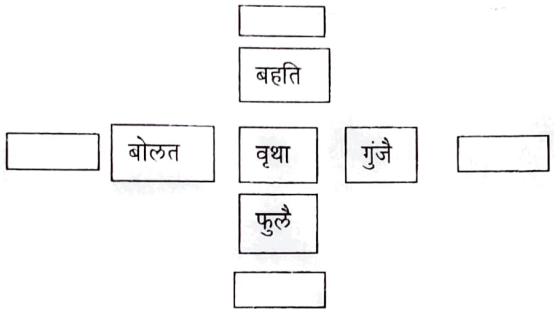

२

बिनु गोपाल बैरिन भई कुंजै।

२ तब ये लता लगति अति सीतल, अब भई विषम ज्वाला की पुजै।।

६ वृथा बहति जमुना, खग बोलत, वृथा कमल फलैं, अलि गुंजै

पवन पानि धनसार संजीवनि दधिसुत किरन भानु भइ भुंजै।।

ए, उधौ, कहियो माधव सौं बिरह कदन करि मारत लुंजै।

सूरदास प्रभु को मग जोवत अँखियॉ भईं बरन ज्यों गुजै।।८५।।

२) श्रीकृष्ण के बिना गोपियों की क्या स्थिति हुई है। इसका वर्णन आठ–दस पंक्तियों में कीजिए। २

प्र. ३) अ) निम्नलिखित परिच्छेद पढकर सुचनाओं के अनूसार कृतियॉ कीजिए। ६

संजाल पूर्ण कीजिए।

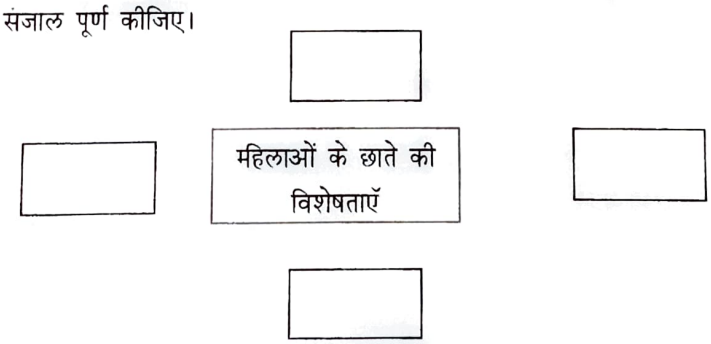

महिलाएँ और खासकर नौकरी पेशा महिलाएँ अपना छाता बगल में दाबकर चलती है। एक तो इनके छाते छोटे–छोटे होते है। वजन में हलके और इनमें वह भालेनुमा नोक नहीं होती जैसी मरदाने छातों में होती है। पता नहीं, इसके मूल में छाता बनाने वालों का तर्क क्या है। यदि पुरूष अपना छाता बगल में दाबकर चले तो इसके पिछे आने वालों को असुविधा होती है। वह

भालेनुमा नोक चुभ सकती है। पर महिलाओं का पीछा करने मे ऐसा कोई खतरा नहीं है। मरदों की किस्मत में लंबे छाते लिखे है। छडी–जैसी लिए चलना पडता है

जिन दिनों स्कूल जाते थे, छाता कंधे पर लटका लेते थे। दोनों हाथ खाली रहते थे और बडे मजे से अवारागर्दी की जा सकती थी। कंधे मोटे नहीं थे, छाता फिट आ जाता था। अब कंधे पर छाता रख चार कदम चलना कठिन है। नही जमता। कंधे पर सुग्गा बिठाकर चलने वाले का ध्यान जिस तरह कंधे पर ही लगा रहता है, वैसा ही जाता है।

कुछ समझ नहीं आता। चार पॉच दिनों से हाथ मे छाता लेकर शहर में घूम रहा हूँ और हर तरह से कोशिश करके देख चुका छाता लेकर चलना एक मुसिबत है। एक छोटी–सी साधारण वस्तु मेरे पूरे व्यक्तित्व को आकार देने लगती है। मै अपने को सुस्त और व्यर्थ अनुभव करने लगता हूँ। चाहे हुँ नहीं, पर 'स्मार्ट' लगता चाहता हुँ। छाता लगने नहीं देता। अजीब देसी मध्यमवर्गीय नजर आता हूँ। उम्र ज्यादा लगने लगती है। कुछ ढीला और निराश–सा आदमी मुसीबत में फॅसा, अपने को बचाता हुआ,ख सुरक्षा की तलाश में, फूँक–फुँककर कदम रखकर चलने वाला, अपने को बडा होशियार लगाने वाला मूर्ख। कल मैने दिन–भर यों किया कि बंद छाते को बिलकुल बीच से पकड लिया जैसे पुलिस वाले डंडा पकडते हैं। मैने सोचा कि इत तरह मै इस छाते को अपने व्यक्तित्व का हिस्सा नहीं बनने दुंगा। वह मुझसे अलग लगेगा जैसे किसी दूसरे का छाता हो और मैं उसें लौटाने जा रहा है। पर एक तनाव सा बना रहा। पुलिस वाले जैसे डंडे को पकडते है यदि उस तरह छाता पकडूँगा तो तनाव रहेगाा। कुछ समझ नहीं आता। (छाते को नापसंद करने का यह अर्थ नहीं कि रेनकोट का भक्त हूँ। उसमें तो अजब जमादार नजर आता हूँ या सी.आई.डी. का शक्की आदमी। उससे ऊबकर ही मै चार–पॉच दिनों से छाता लिए घूम रहा हूँ।)

२) कृती पूर्ण कीजिए। २

लेखक के मतानुसार छाते के कारण व्यक्तित्व मे पैदा होनेवाने दोष

१) २)

३) ४)

३) बरसात के दिनों मे छाता न होने के कारण आपकी हुई फजिहत का ८ से १० पंक्तियों में वर्णन लिखिए। २

आ) निम्नलिखित परिच्छेद पढकर सूचनाओं के अनुसार कृतियॉ कीजिए।

संजाल पूर्ण कीजिए। २

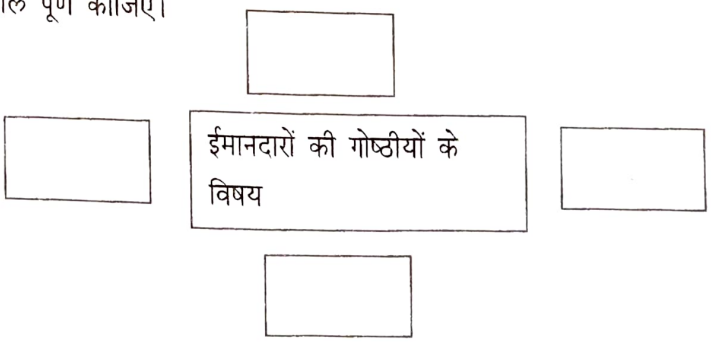

उद्घाटन शानदार हुआ, मैने लगभग एक घंटे तक ऐसा अच्छा भाषण किया कि मुझे अभी तक शर्म आ रही है।

लोग जा चुके थे। मै था मुख्य अतिथि। मुझसे लोग बाते कर रहे थे। मै चलने लगा, तो चप्पल पहनने गया। देखा, मेरी चप्पलें गायब थी। न और अच्छी चप्पले थी। अब वहाँ तक जोडी फटी–पुरानी चप्पले बची थी मैने उन्हे ही पहन लिया। यह बात फैल गई कि मेरी नई चप्पल कोई पहन गया।

एक ईमानदार डेलीगेट मेरे कमरे मे आए। कहने लगे, ''क्या आपली चप्पलें कोई पहन गया?''

मैने कहा, हाँ ''इतने बडे जलसे में चप्पलें की अदला बदली हो ही जाती है।''

फिर मैंने ध्यान से देखा, उनके पाँव में मेरी ही चप्पलें थीं वह भी मेरी चप्पलें देख रहे थे। वे बहुत करके उनकी ही थी।

पर वह बेहिचक मुझे समझाने लगे, ''देखिए, चप्पलें एक जगह नहीं उतरनी चाहिए। एक चप्पल यहाँ उतरिए, तो दूसरी दस फीट दूर। तब चप्पलें चोरी नहीं जाती। एक ही जगह जोडी होगी, तो कोई भी पहन लेगा। मैने ऐसा ही किया था।''

मै देख रहा था कि वह मेरी चप्पलें पहने है और मुझे समझा रहे है।

मैने कहा, कोई बात नहीं। सुबह दूसरी खरीद लूँगा। आपकी चप्पलें नहीं गई, यह गनीमत है।

फिर मैने देखा कि एक बिस्तर की चादर गायब है। मैने आयोजनकर्ताओं से कहा, तो उन्होंने जवाब दिया, ''होटलवालो ने धुलने को भेज दी होगी। दूसरी आ जाएगी। पर दूसरी आई नहीं।''

दूसरे दिन गोष्ठियाँ शूरू हो गई। विषय बडे अच्छे थे: १) ईमानदारी: ऐतिहासिक परिपेक्ष्य में २) धर्म और ईमान ३) बेईमानी का सौदर्य शास्त्र ४) ईमानदारी और आधुनिकता।

सबसे ऊँचे स्तर की चर्चा हुई बेईमानी के सौदर्यशास्त्र पर। श्रोताओं ने बडी तारीफ की कि ईमानदारों के सम्मेलन में बेईमानी के सौदर्यशास्त्र पर चर्चा बहुत जरूरी थी। यह एक उपलब्धि है।

२) चप्पलों को लेकर लेखक के साथ घटना हुई? २

प्र. ४) १) निम्नलिखित वाक्यों में से किन्ही दो वाक्यों का कोष्टक मे दी गई सुचना के अनुसार कालपरिवर्तन कीजिए। २

१) महाराज के मुख पर मधुर मुस्कान खिल रही है। (पूर्ण भूतकाल)

२) तुमने कोशल का उपकार किया। (अपूर्ण वर्तमानकाल)

३) दोपहर का भोजन इसी तरह दुकान में ही होता है। (सामान्य भविष्यकाल)

२) निम्नलिखित वाक्यों में से किन्ही दो के रचना के अनुसार भेद लिखिए। २

१) कितने दिनों से उसका एक सपना था कि उसका भी एक ठेलिया हो।

२) यदि वह बलवान होते, तो उस बदमाश का खून पी जाते।

३) अब मेरी चिंता बढ चली थी।

३) निम्नलिखित मुहावरों में सं किन्हीं दो के अर्थ लिखकर वाक्यों में प्रयोग किजिए। २

१) धावा बोलना २) हड्डी पसली एक कर देना ३) नाक में दम होना

४) दहल जाना

४) निम्नलिखित में से किसी एक शब्द का भाववाचक संज्ञा रूप लिखिए। १

१) व्याकुल २) मजदूर

५) निम्नलिखित में से किसी एक शब्द का विशेषण रूप लिखिए। १

१) पुस्तक २) कृपा

६) निम्नलिखित वाक्यों में से किन्हीं दो वाक्यों को शुध्द करके फिर से लिखिए।

१) इतने मे पुलिस भी वहाँ पहुँच चुका था।

२) विज्ञापनों द्वारा जनता कि मनोवृत्ती का निर्माण होता है।

३) मिल भर दूरी पर पूरब के कोने में एक जरमनी खाई है।

प्र ५) निम्नलिखित विषयों में से किसी एक विषय पर लगभग २०० से २५० शब्दों मे निबंध लिखिए। (केवल एक) १०

१) यदि मै शिक्षामत्री होता।

२) पेड की आत्मकथा

३) कंप्युटर एक वरदान।

४) विज्ञान वरदान या अभिशाप

५) मेरा प्यारा गॉव

प्र. ६) अ) निम्नलिखित विषयों मे से किसी एक पत्र का नमूना तैयार कीजिए। ५

१०८, सिविल लाइन्स, आनंदपुर से रमेश/रमा पाठक अपने प्राचार्य, दलाल कनिष्ठ महाविद्यालय, आनंदपुर को छात्रवृत्ति प्रदान करने हेतु आवेदन करता,करती है।

आ) निम्नलिखित गदयांश पढकर पॉच ऐसे प्रश्न तैयार कीजिए जिनके उत्तर एक एक वाक्य में हों। ५

गीता जीवन की कला सिखाती है। जब मै देखता हूँ कि हमारा समाज आज हमारी संस्कृति के मौलिक सिध्दांतों की अवहेलना करता है, तब मेरा हृदय फटता है। आप चाहे जहॉ, परंतु संस्कृती के मौलिक सिध्दांतों को सदैव साथ रखे। संसार के सारे सुख क्षणभंगुर एवं अस्थायी होते हैं। वास्तविक सुख हमारी आत्मा में ही है। चरित्र नष्ट होने से मनुष्य का सब कुछ नष्ट हो जाता है। संसार के राज्य पर विजयी होने पर भी आत्मा की हार सबसे बडी हार है। यही है हमारी संस्कृति का सार, जो अभ्यास द्वारा सुगम बनाकर कार्यरूप में परिणत कियां जा सकता है।

इ) नयी अगरबत्ती की अधिकतम खपत होने के लिए आकर्षक विज्ञापन तैयार कीजिए। ४

डी. बी. जे. कनिष्ठ महाविद्यालय, चिपळूण.

वेळ- ३ तास | वार्षिक कृतिपत्रिका-२०१९ | गुण- ८०

वर्ग:- ११ वी (वाणिज्य) | विषय- मराठी

१- १. *(अ) खालील उताऱ्याच्या आधारे दिलेल्या सूचनेनुसार कृती करा.* (०८)

१. हलद्वानीपासून काठगोदामाचे अंतर ⟶ [ ] (०१)

२. मन या नामासाठी उताऱ्यात वापरलेली विशेषणे सांगा. (०१)

१) ( ) २) ( )

गाडीनं बरेली सोडलं आणि मी मोठ्ठा श्वास घेतला. म्हटलं, 'आता हा कुमाऊँ प्रदेश. आता हलद्वानी जवळ येईल. तिथून अवघ्या सहा - सात किलोमीटरवर काठगोदाम. रेल्वेची धाव फक्त तिथवरच. पुढे तिला धावता येणार तरी कस? हिमालयाच्या चरणांशी वळून तिनं परतच फिरायला हवं. आता दिसतील मला हिमालयाच्या उत्तर - पूर्वेच्या पर्वतरांगा. खाली गंगा - यमुनेचं खोरं भट्टीसारखं तापलं आहे. मी देखील अगदी भाजून निघाले आहे. मन शरीरासारखंच कलकलतं आहे. रोजच्या चाकोरीत अगदी कसनुसं होऊन गेलेलं आहे. आता हिमालय पहायचा आहे डोळे भरून. शरीर - मन शांत करायचं आहे!'

खरचं, मी तेवढ्यासाठी तर निघाले होते. दर उन्हाळ्यात, थंड हवेच्या ठिकाणी सहज जाऊन राहणाऱ्या वर्गातील मी नव्हते, दुर्दम्य उत्साहानं हिमशिखरांची चढाई करू पाहणाऱ्या साहसवीरांपैकी मी नव्हते किंवा सश्रद्ध भक्तिभावानं देवात्मा, हिमालयाच्या कुशीतली पुण्यक्षेत्रं पहायची ओढ वाळगूनही धावत आले नव्हते. याच्याच दुसऱ्या बाजूने बोलायचं, तर साहसाची, चैनी निवांतपणाची किंवा भक्तिची कसलीच पुंजी माझ्या गाठी नव्हती आणि तरी जमेल तशी धडपड करून इतक्या लांब मी निघाले होते, ती का?

केवळ हिमालयाचा स्पर्श हवा म्हणून माझ्या क्षुद्र जीवाला एकदा तरी भारतभूमीच्या त्या अभेदय मानदंडाचं सुवर्ण दर्शन हवं होतं. किती तरी ऐकलेलं-वाचलेलं मनात उसळी मारून वर येत होतं. मन अगदी उत्सुक, अधीर झालं होतं. प्रथम त्या डोंगररांगा दिसल्या. हलद्वानीजवळ जात असताना अगदी फिक्या जांभळट पर्वतांच्या ओळी स्वप्नात रेखाव्या तशा धूसर, अस्पष्ट. आमरायांनी दाटलेल्या विस्तीर्ण सखल प्रदेशाची सीमा इथं संपते.

३. प्रवास करण्याचे फायदे ८ ते १० ओळीत तुमच्या शब्दात लिहा. (०२)

४. तुम्ही भेट दिलेल्या निसर्गरम्य ठिकाणाचे वर्णन तुमच्या शब्दात १२ ते १५ ओळीत करा. (०४)

किंवा

'लेखिकेला हिमालयाच्या कुशीतील पुण्यक्षेत्रं पहाण्याची ओढ' या ओळीतील आशय १२ ते १५ ओळीत स्पष्ट करा.

१- १. (ब) खालील उताऱ्याच्या आधारे दिलेल्या सूचनेनुसार कृती करा. (०४)

१) पुढील शब्दाला विरूद्धार्थी शब्द लिहा. (०१)

अंधश्रद्धा X [ ]

अंधार X [ ]

२)उताऱ्यातील एक संयुक्त वाक्य शोधून लिहा ⟶ [ ] (०१)

१९७३ साली जेव्हा 'लोकविरादारी प्रकल्प' सुरू झाला तेव्हा इथले माडिया गोंड, आदिवासी भूक, रोगराई, अंधश्रद्धा यांच्या विळख्यात सापडले होते. भामरागडच्या जंगलापलीकडचं दुसरं जग त्यांना माहीत नव्हतं. या जगाच्या चालीरीती कायदे कानून त्यांच्या ओळखीचे नव्हते. वाहणाऱ्या नद्या आणि जंगली जनावरं यांच्या आवाजापलीकडे तिसरा आवाज या भागात ऐकू येत नव्हता. इथला परिसर सुंदर होता, पण ते सौंदर्य रौद्र होतं. जगापासून पूर्ण तुटलेल्या या समाजाला मुख्य प्रवाहाची ओळख करून दयायचं हे आव्हान आम्ही सगळयांनी स्वीकारलं आणि थोडयाफार प्रमाणात यशस्वीही करून दाखवलं. आज हेमलकशाला चाळीस खाटांचं हॉस्पिटल आहे. तिथे उपचार करून घ्यायला लांबलांबून लोक येतात. इथल्या आदिवासींची मुलं आज शाळेत शिकून शहाणी होताहेत, बाहेरच्या जगात जाऊन नोकऱ्या करताहेत. आज इथे हिरवीगार शेती पिकते. इथल घनदाट जंगल अजून तसंच आहे; पण पक्ष्यांच्या किलबिलाटानं आणि माणसांच्या चाहुलीनं त्याला चैतन्य आलंय. दळणवळणाच्या साधनांनी हेमलकसा आणि वाकीचं जग यात एक पूल बांधला गेलाय. हा सगळा प्रवास 'अंधाराकडून उजेडाकडे' असा होता.

१. तुम्हाला माहीत असलेल्या एका समाजसुधारकाची माहिती ८ ते १० ओळीत तुमच्या शब्दांत लिहा. (०२)

किंवा

लोकविरादारी प्रकल्प सुरू झाल्यानंतर झालेल्या सुधारणा उताऱ्याच्या आधारे ८ ते १० ओळीत तुमच्या शब्दांत लिहा.

कृती - २. (अ) खालील कवितेच्या आधारे दिलेल्या सूचनेनुसार कृती करा.

१. परमेश्वराच्या जागी असणारी → ◯

जग पहाण्याची इच्छा व्यक्त करणारी → ◯

२. **पुढील कवितेतील यमक साधणारे शब्द लिहा.**

तू जसे पाहिले जग मला देखील पाहू दे
सांग आई वावांना जन्म मला घेऊ दे ।।धृ।।
परमेश्वर प्रत्येकाच्या घरी जाऊ शकत नाही
त्याच्या जागी तू आहेस कसे तुला कळत नाही
ताईसवे माझ्या मला आनंदाने न्हाऊ दे
सांग आई वावांना जन्म मला घेऊ दे ।।१।।
हुंडा लागतो मोठा म्हणून त्रास माझा वाटतो का?
झरा तुझ्या मायेचा म्हणून असा आटतो का?
राखीसाठी दादाच्या निदान मला येऊ दे
सांग आई वावांना जन्म मला घेऊ दे ।।२।।
तू वहीण तू कन्या तू एक स्त्री आहे
काल तिथे तू होती आज तिथे मी आहे
तू जसे विणले नाते तसे मला विणू दे
सांग आई वावांना जन्म मला घेऊ दे ।।३।।
पहा मग फिरून मी पुन्हा कधी येणार नाही
भाग्य कन्यादानाचे दोघांनाही देणार नाही
डोळे येता भरून तुझे पदर मला होऊ दे
सांग आई वावांना जन्म मला घेऊ दे ।।४।।

३. मातेच्या गर्भातील मुलीने व्यक्त केलेली इच्छा तुमच्या शब्दांत १२ ते १५ ओळीत लिहा.

किंवा

तुम्हाला माहीत असलेल्या एका कर्तृत्त्ववान स्त्रीची माहिती तुमच्या शब्दात १२ ते १५ ओळीत लिहा.

२. 'लेक वाचवा' या मोहिमेसंदर्भात तुमचे मत ८ ते १० ओळीत लिहा.

कृती - २. (ब) खालील कवितेच्या आधारे दिलेल्या सूचनेनुसार कृती करा.

१. आकृतीबंध पूर्ण करा.

i) सह्याद्रीच्या कडयाकडून → ☐
ii) भरलेल्याश्या भीमेकडून → ☐

२. 'आपल्यात देखील देण्याची वृत्ती वाढीस लागावी' या अर्थाची ओळ कवितेत शोधून लिहा → ☐

देणाऱ्याने देत जावे, घेणाऱ्याने घेत जावे
हिरव्या पिवळया माळाकडून, हिरवी पिवळी शाल घ्यावी
सहयाद्रिच्या कडयाकडून, छातीसाठी ढाल घ्यावी
वेडयापिश्या ढगांकडून, वेडेपिसे आकार घ्यावे
रक्तामधल्या प्रश्नांसाठी, पृथ्वीकडून होकार घ्यावे
उसळलेल्या दर्याकडून, पिसाळलेली आयाळ घ्यावी
भरलेल्याश्या भीमेकडून, तुकोबांची माळ घ्यावी
देणाऱ्याने देत जावे, घेणाऱ्याने घेत जावे
घेता घेता एक दिवस, घेणाऱ्याचे हात घ्यावे.

- विंदा करंदीकर

३. 'दिल्याने वाढते' या विषयी ८ ते १० ओळीत तुमचे मत लिहा.

४. वरील कवितेचा आशय ८ ते १० ओळीत तुमच्या शब्दात स्पष्ट करा.

कृती - ३. खालील सूचनेप्रमाणे कृती करा.

(अ) समानार्थी शब्दांचा योग्य पर्याय निवडा.

१. चेहरा

य) रदन र) मदन ल) वदन व) सदन

२. मृदा -

य) माती र) नाती ल) गती व) सती

(ब) विशेषण ओळखून योग्य पर्याय निवडा

१. संपतने तीनशे रूपयांची पुस्तके विकत घेतली.
य) सार्वनामिक विशेषण र) संख्याविशेषण ल) गुणविशेषण

२. तिला विमान प्रवासाचा अनुभव नव्हता.
य) सार्वनामिक विशेषण र) संख्याविशेषण ल) गुणविशेषण

(क) १. खालील शब्दांतील उपसर्गघटित शब्द ओळखा.

य) अवमान र) कापरा ल) हसरा व) गावकी

खालील शब्दांतील प्रत्ययघटित शब्द ओळखा. (०१)

य) अतिरिक्त र) भरदिवसा ल) वेडा व) निकामी

(ड) खालील वाक्यांच्या प्रकाराचे योग्य पर्याय निवडा. (०२)

१. मी इयत्ता अकरावीमध्ये शिकत आहे.

य) मिश्र वाक्य र) संयुक्त वाक्य ल) केवल वाक्य

२. पंतप्रधान म्हणाले की युवकांनी उदयमशील बनावे.

य) मिश्र वाक्य र) संयुक्त वाक्य ल) केवल वाक्य

(इ) खालील वाक्प्रचारांच्या अर्थांचा योग्य पर्याय निवडा. (०२)

१. जीवापाड मेहनत करणे -

य) जीवाला सांभाळणे र) अतिशय कष्ट करणे ल) कष्टाचा देखावा करणे

२. नवी दृष्टी मिळणे -

य) नवीन चष्मा घेणे र) नवीन पैलू कळणे ल) चष्म्याचा नंबर बदलणे.

(फ) खालील दिलेल्या पर्यायांतून पारिभाषिक शब्दांसाठी योग्य पर्याय निवडा. (०२)

१) Keyboard -

य) कळफलक र) गुरुकिल्ली ल) वार्तापत्रक व) धावफलक

२) Feeling -

य) निंद्रा र) पत्र ल) शब्द व) भावना

३) Match -

य) खेळी र) सामना ल) झुंज व) पदक

४) Cheque -

य) कर्जदार र) धनादेश ल) सावकार व) खात

प्र. ४. खालील उताऱ्याच्या आधारे दिलेल्या सूचनेनुसार कृती करा. (०८)

१) जयवंतची निवड या शिबीरासाठी झाली → [ ] (०१)

२) जयवंतची शेतीकडे ओढला जाण्याची दोन कारणे [ ] — [ ] (०१)

जयवंत इलेक्ट्रॉनिक्स विषयात अभियांत्रिकी शाखेची पदवी घेतली आहे. त्यानंतर इ - बिझनेस या विषयात एमबीएही केलं आहे. सहाजिकच त्याच्या शैक्षणिक पात्रतेनुसार त्याला मोठ्या पगाराची नोकरीही मिळाली. भविष्य उज्ज्वल असतानाही जयवंतच्या मनात मात्र अनामिक अस्वस्थता होती; पण ती का आणि कशामुळे हे त्याला माहित नव्हतं. एक मात्र त्याला पक्क माहीत होतं, की फक्त एवढंच आणि एवढंच नाही करायचं. याच्यापेक्षा वेगळं काहीतरी करायचं तेही मनाला समाधान देणारं. याच दरम्यान जयवंतची डॉ. अभय बंग यांच्या 'निर्माण' या शिबिरासाठी निवड झाली. दोन वर्षाच्या काळात जयवंत 'निर्माण' मधल्या अनेक शिबिरांमध्ये सहभागी झाला. शेतीच्या प्रश्नांवर काम करणारे त्याला अनेकजण तिथे भेटले. देशी बियाणाचं संवर्धन, शेतमजुरांचे प्रश्न अशा शेतीशी निगडित प्रश्नांवर काम करणाऱ्या अनेकांना त्याला जवळून बघता आलं आणि तिथे त्याला शेतीच्या खऱ्या प्रश्नांची ओळख झाली. लहानपणी मामाच्या गावी असलेली शेती एवढाच काय तो जयवंतचा शेतीशी संबंध. पण मनाला असलेली शेतीची अनामिक ओढ आणि शेतीच्या प्रश्नांवर काम करण्याची इच्छा यामुळे जयवंत शेतीकडे ओढला गेला. शेती संदर्भातली अनेक पुस्तकं त्याने वाचली, इंटरनेटवरून माहिती जमवली, अनेक शेतकऱ्यांच्या, कृषितज्ज्ञांच्या भेटीगाठी घेऊन शेती समजून घेण्याचा प्रयत्न केला आणि नुसतच कुंपणावर बसून न राहता जयवंतने २०११ साली वाडेगव्हाणं इथे आपल्या आजवरच्या मिळकतीतून तीन एकर शेती घेतली आणि ती कसायला सुरूवात केली. इथे जयवंतने विषमुक्त शेतीचा प्रयोग केला.

३. 'माझे ध्येय' या विषयी ८ ते १० ओळीत माहिती लिहा. (०२)

४. शेती करण्यासाठी जयवंतने केलेले प्रयत्न १२ ते १५ ओळीत तुमच्या शब्दांत लिहा. (०४)

किंवा

'शेती' या विषयावर तुमचे मत १२ ते १५ ओळीत लिहा.

प्र. ५. (क) खालील उताऱ्याच्या आधारे सूचनेनुसार कृती करा. (०८)

१) निसर्गाने मानवाला दिलेल्या दोन देणग्या. → [ ] (०१)

२) भाषेची व्याख्या लिहा - _____ (०१)

मानवाकडून संवादासाठी वापरले जाणारे 'ध्वनिनिष्ठ' साधन म्हणजे भाषा होय. ध्वनिनिर्मितीच्या क्षमतेच्या झाल्यामुळे मानवाला भाषेची निर्मिती करून वापर करता येऊ लगला. भाषा बोलणे म्हणजे विचारांना मुखावाटे विविध उच्चारणाने व्यक्त करणे. या प्रकाराला भाषेचा मौखिक वापर असे म्हणतात. मौखिक भाषेच्या वापरातून लोकसाहित्याची झाली. लिपिचिन्हे शोधून काढल्यानंतर ध्वनींना लिपिचिन्हे दिली गेली. लिपिचिन्हांच्या साहाय्याने भाषेचा वापर प्रकाराला भाषेचा लिखित वापर असे म्हणतात.

३) भाषेचे मानवाच्या जीवनातील महत्त्व १२ ते १५ ओळींत तुमच्या शब्दांत लिहा.

किंवा

भाषा हा मानवाच्या जीवनातील अनन्यसाधारण घटक आहे या विधानाबाबत १२ ते १५ ओळींत तुमचे मत लिहा.

४) 'शिक्षण नसते तर' या विषयी ८ ते १० ओळीत माहिती लिहा.

कृती - ६. (अ) खालीलपैकी कोणत्याही एका विषयावर सुमारे २५० शब्दांत कल्पनाविस्तार करा.

१) केल्याने होत आहे रे आधी केलेची पाहिजे.

२) व्यायामाचे जीवनातील महत्त्व.

३) वृक्षवल्ली आम्हां सोयरे.

(ब) तुमच्या कनिष्ठ महाविद्यालयाच्या वार्षिक क्रीडा पारितोषिक वितरण समारंभाची बातमी पुढील घटकाच्या आधारे तयार करा.

(मथळा - शिरोभाग - तपशील - समारोप)

किंवा

'गुणवंत विद्यार्थ्यांचा सत्कार' याविषयीची बातमी लिहा.

(मथळा - शिरोभाग - तपशील - समारोप)

(क) खालील विषयावर लिखित माध्यमांसाठी जाहिरात तयार करा.

१) मे महिन्याच्या सुट्टीत विद्यार्थी - विद्यार्थिनींसाठी सुरू केलेले 'कराटे' वर्ग.

२)सौरबंब.

(ड) खालीलपैकी कोणत्याही एका विषयावर सूत्रसंचालनाचा नमुना तयार करा.

१) 'शिक्षकदिना' निमित्त आयोजित केलेल्या सूत्रसंचालनाची कार्यक्रमपत्रिका तयार करा.

२)'संतुलित आहार व योग' हया आयोजित शिबिरासाठी सूत्रसंचालनाची कार्यक्रमपत्रिका तयार करा.

(इ) खालील उताऱ्याच्या आधारे सूचनेनुसार कृती करा.

१)



२)

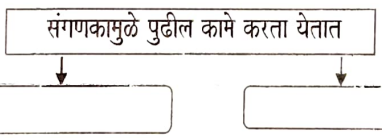

संगणकाच्या शोधाने मानवाचे भौतिक व बौद्धिक जीवन आमूलाग्र बदलेले आहे. संपूर्ण समाजजीवन संगणकाचा विलक्षण प्रभाव आहे. सर्व क्षेत्रांमध्ये संगणकाचा उपयोग केला जात आहे. आपली पुस्तके, रोजचीं संगणकाच्या साहाय्याने तयार होतात. वीज बिल,दूरध्वनी बिल, एखादया दुकानाचे किंवा हॉटेलचे बिल हे संगणक भरता येते. बँका, कार्यालयांचे व्यवहार संगणकावरच होतात. इतकेच नव्हे तर, आजारांचे निदान करण्यासाठी विमान चालविण्यासाठीही संगणक वापरला जातो. माहिती, मनोरंजन व संपर्क यासाठी संगणकाबरोबरच आंत इंटरनेटची गरज भासते. इंटरनेटसाठी मराठीतील संज्ञा 'महाजाल' आहे. काही वेळा महाजालाऐवजी 'आं अशीही संज्ञा वापरलेली दिसते. या महाजालामुळे सारे जग जोडले गेले आहे. म्हणजेच महाजालाचा उपयोग जगातील कोणत्याही ठिकाणी संपर्क साधणे सहज शक्य झाले आहे. एखादया खेडयात जसे कोणीही कोणाशी सं शकतात, व्यवहार करू शकतात, तसेच महाजालाचा उपयोग करून जगभरातील कोणालाही क्षणार्धात पत्र संगणकाला कॅमेरा जोडलेला असेल तर एकमेकांना समोरासमोर पाहून गप्पा करणे शक्य झाले आहे. त्यामु एखादया खेडयाप्रमाणे छोटे झाले आहे, असे म्हटले जाते. त्यासाठी 'ग्लोबल व्हिलेज' असा शब्दप्रयोग केल महाजालावरील संकेतस्थळांवरून (Website) आपल्याला विविध माहिती मिळवता येते. इलेक्ट्रॉनि (e – mail) पाठवता येते आणि स्वत:चे विचार मांडण्यासाठी अनुदिनी (Blogs) तयार करता येते. या सं जशा इंग्रजीतून करता येतात, तशा मराठी भाषेत देवनागरी लिपी वापरूनही करता येतात.

३) संगणकामुळे मानवी जीवनात झालेली क्रांती १० ते १२ ओळींत तुमच्या शब्दांत लिहा.

D.B.J.College,Chiplun
Annual Examination Year 2018-19
Sub: Information Technology

Time: 2&1/2hrs. **Class: XI Commerce** **Marks:80**

Q.1 Fill in the blanks **(10)**

1. DBMS stands for.....
2. The.....image editing tool is used to remove unwanted part or extra areas present in an image.
3. To reduce the amount of fragmentation, ...process is used in a Disk.
4. In Tally,..... ...Key is used to invoke calculator on Gateway Of Tally screen.
5. The.....attribute specifies the alignment of the heading tag.
6. In Excel, cells are formed by.....and columns.
7. The.....facility in Word 2007 can be used to send letters to number of recipients.
8. The.....option is used from Company Info menu to make the changes in the company creation screen in Tally.
9. The.....refers to the creation, gathering, processing, storage and delivery of information.
10. .....is a set of all data fields for one row of a table in the database.

Q.2 State TRUE or FALSE. **(10)**

1. HTML is a system programming language.
2. Trial balance is a statement of assets and liabilities.
3. The function of DBA is to define a database schema.
4. Logic Bombs are considered as viruses.
5. WWW stands for Wide Wide Web.
6. Multimedia is very effective presentation and sales tool.
7. MIDI stands for Musical Instrument Digital Interface.
8. In PowerPoint 2007, the title bar displays the name of the presentation on which you are currently working.
9. The Font dialog box is used to search for and optionally replace a string of characters with another string of characters.
10. The microprocessors are used in personal computers or other general purpose computers.

Q.3 Multiple Choice Single Answer.(ONE CORRECT ANSWER) **(20)**

1. Which of the following is a subgroup under the Current Assets group in Tally?
   (a)Sundry Creditors (b)Sundry Debtors (d)Provisions (d)Unsecured Loans
2. A group of more than 8 bits is usually known as a .....
   (a)Nibble (b)Byte (c)Word (e)Number
3. The.....software has direct control and access to your computer hardware and memory locations.
   (a)Application (b)Antivirus (c)Command (d)System
4. The .....tag is used to display the title of a web page.
   (a)<HEAD> (b)<TITLE> (c)<HTML> (d)<BODY>
5. A.....can help to protect your computer by preventing hackers or malicious software.
   (a)Encryption (b)Firewall (c)Password (d)Antivirus software
6. The .....view is used to deliver the presentation in front of the audience.
   (a)Slide sorter (b)Normal (c)Slide show (d)Slides
7. Tally provides a set of total.....number of predefined groups.
   (a)28 (b)15 (c)13 (d)16
8. In Word 2007, in the Page Layout tab, under page setup group,.....option allows user to change the paper size.
   (a)Page background (b)Size (c)Orientation (d)Margins
9. The process of making an archival file is called.....
   (a)Extracting (b)Combining (c)Archiving (d)Separating
10. The.....is the raster image file format commonly used on web.
    (a)Bitmap (b)Sitmap (c)Map (d)EPS
11. In Tally, ...key is used to change the accounting period of the company.
    (a)Alt+F1 (b)Alt+F2 (c)F2 (d)Alt+F3
12. The ....protocol is used to transfer files easily from client computer to server computer .
    (a)POP (b)HTTP (c)SMTP (d)FTP
13. Following command is used in Data Manipulation Language. of the database.
    (a)Insert (b)Rollback (c)Create (d)Lock
14. The .....tag is used to display the title of the table in HTML.
    (a)<Title> (b<Caption> <c)<TableCaption> (d)<TH>

15. The.....is a statement of assets and liabilities.
(a)Payment sheet (b)Balance sheet (c)Enroll Sheet (d)Purchase sheet
16. The ledger Goodwill a/c comes under the primary group of.....in Tally.
(a)Current Assets (b)Fixed Assets (c)Investments (d)Capital Account
17. .....are any facts, numbers or text that can be processed by a computer.
(a)Information (b)Data (c)Elements (d)Modules
18. The .....option is used to save our documents in Word 2007.
(a)Open (b)Print (c)Arrange (d)Save
19. Following is one of the database relationship
(a)One-to-Many (b)Many-to-one (c)More to-Many (d)One-to-More
20. The.....is a presentation software package of the company Microsoft.
(a)Word (b)Excel (c)PowerPoint (d)Access

Q.4. Multiple Choice Multiple Answers.(TWO CORRECT ANSWERS)

1. The align attribute is used with following two tags in HTML.
(a)<A> (b)<TABLE> (c)<BODY> (d)<B> (e)<IMG>
2. Which of the following ledger accounts are opened by Tally when user creates a new company by default?
(a)Profit & loss A/C (b)Bank A/C (c)Bank Loan A/C (d)Cash A/C (e)Purchase A/C
3. Which of the following are database languages?
(a)DDL (b)DFL (c)DQL (d)DWL (e)DCL
4. Generic top-level domains for non-profit organization are as follows.
(a).com (b).dmn (c).org (d).cnm (e).ghj
5. The two types of data compression algorithms are .....
(a)Lossy compression (b)Old compression (c)Lossless compression
(d)New compression (e)Serial Compression

Q.5 Multiple Choice Multiple Answers.(THREE CORRECT ANSWERS)

1. Which of the following ledger accounts come under primary group Indirect Incomes?
(a)Discount received (b)Discount allowed (c)Commission received
(d)Commission paid (e)Rent received (f)Interest paid
2. Which are stand alone tags among the following?
(a)<img> (b)<head> (c)
 (d)<hr> (e)<B> (f)<I>

Q.6 Rearrange the following.

1. Rearrange the following steps to delete a ledger in Tally
a)Select Alter from single Ledger
b)Select Accounts Info menu
c)Select the ledger to delete from the list
d)Select Gateway Of Tally menu
e)Select Ledgers from Accounts Info menu
f)Press Alt+D to delete the selected ledger

2. Rearrange the following HTML code for displaying table with one cell
a)<table> (b)<td>Good Luck (c)<tr> (d)<html>
e)</td> (f)</table> (g)</html> (h)</tr>

Q.7. A. Answer in Short.

1. Explain the Font dialog box in Ms Word 2007.

B. Answer in Brief.

1. Explain any eight points of differentiations between Spreadsheet and Database.
2. Explain the basic structure of a Computer.

Q.8. Answer in brief.

1. Write a HTML code to display the information of "Your School'. The web page must contain heading tags and physical style tags.
2. Explain the opening screen of Tally.

****

D.B.J. COLLEGE ; chiplun

Annual Examination 2018-19

XI-COMMERCE 'B'

Subject:- Banking Paper-II

Time:- 3 Hrs. **Marks:- 80**

(10)

Note:-1. All questions are compulsory.

2. Figures to the right indicate full marks.

SECTION-A

Q.1 A) Fill in the blanks:- **5**

1. A Cheque is payable on_____

2. _____provides loan to economically backward people.

3. A document used to withdraw money from the bank is known as_____

(06)

4. _____are regarded as native bill of exchange.

5. If only part of the amount of instrument is endorse, it is called as_____

B) Answer the following in One or Two lines each:- **5**

1. Who is a Borrower ?

(04)

2. Who is a Collecting banker?

3. What is a Special Crossing?

4. State parties of a Cheque.

5. What is Pay-in-slip?

Q.2) Answer in short any FIVE of the following:- **10**

1. State Agency functions of bank.

)2) 2. Define Cheque.

3. What is Conditional endorsement? Give an example.

8) 4. State any two items of Asset side of a bank balance sheet.

5. What is Recurring Deposit account?

6. What is Material Alteration?

)

7. Explain the term Debtor and Creditor.

8. State any two types of cheques with an examples.

Q.3) Explain in brief any FIVE of the following:- **10**

1. Define Endorsement.

2. Explain the term 'Safe Margin'.

3. Write advantages of using cheque.

4. State the importance of bank balance sheet.

5. Explain the term 'Traveller's cheque' and 'Gift cheque'.

6.State the difference between Central bank and Commercial bank.

7. What is Blank Endorsement? Give an example.

8. What is Anti-dated cheque? Write two examples.

Q.4) Define 'Bank'. Explain various types of Banks. 10

OR

What are the special kinds of Bank Customers?

Q.5) What are the precautions to be taken by the Paying banker while making the payment of cheque? 10

OR

Explain the Liabilities side of a Bank Balance Sheet in details.

SECTION-B

Q.6 A) Give Specimens of any TWO of the following with suitable illustration:- 10

1. Pay-in-Slip of Current deposit account
2. Crossed Cheque
3. Withdrawal Slip
4. Pass Book

B) Answer any ONE of the following:- 5

1. Contents of Signature card
2. Contents of Fixed Deposit Receipt

Q.7) On the basis of your visit to Bank, Explain Primary Functions of Bank in detail. 15

OR

Enter the following transactions in proper form of Pass –Book and show the exact balance as on 31st March 2017.

Opening Balance as on 1st March 2017 ₹ 5,000.

Q. 2

Deposit during the month			Withdrawals during the month		
Date		**₹**	**Date**		**₹**
02/03/17	Cheque	3,500	06/03/17		4,000
12/03/17	cash	8,000	19/03/17		10,000
17/03/17	cheque	12,000	25/03/17		15,000
20/03/17	cash	7,500	31/03/17		7,600
23/03/17	cheque	6,800			

Q. 3.

Q. 4.

On 28th March 2017 bank debited ₹ 1,800 for bank charges and on 30th March'17 bank credited ₹ 850 as Dividend.

****

Q. 5.

Q. 6.

D.B.J. College, Chiplun

Annual Exam –March 2019

XI- Commerce

Time: 3:00 Hrs **Subject – Secretarial Practice** **Marks - 80**

Note:- 1)All questions are Compulsory.
2) Figures to the right indicate full marks for the questions.
3) Figures to the left indicate question number.
4) Answer to every question should start on a new page.

Q.1) A) Select the correct answer from possible choice given below and rewrite the statements. **(05)**

1) Registration is _____ for every company.
a) Voluntary b) Compulsory c) Optional

2) The business to be transacted at the meeting is called_____
a) Agenda b) Minutes c) Motion

3) Bank provides overdraft facility to _____ account holder.
a) Saving b) Fixed c) Current

4) An extra ordinary general meeting is held _____
a) Once in a year b) Once in the lifetime c) Under special circumstances

5) Language of business letter should be _____
a) Simple b) Hard c) Flowery

B) Match the pairs. **(05)**

'A' Group		'B' Group
A)	Board Meeting	1) Documents attached with letter
B)	Enclosures	2) Representative of member
C)	Proxy	3) Sea Perils
D)	Promoters	4) Once in three months
E)	Marine insurance	5) Pioneers of company
		6) Concluding part of letter
		7) Once in six months

C) Write a word or a term or a phrase, which can substitute each of the following statements. **(05)**

1) The minimum number of members required to be present at a valid meeting.
2) A report which is prepared before statutory meetings.
3) The name and address of the reader.
4) An invitation to public to subscribe for shares or debentures of company.
5) Insurance which covers the risk of loss by the fire.

Q. 2. Distinguish between the following (Any Three) **(15)**

1) Annual General meeting & Extra ordinary General meeting
2) Agenda and minutes
3) Heading and Inside address.
4) Voting by show of hands and Voting by poll.
5) Fire Insurance and Marine Insurance.

Q. 3. Write short notes. (Any Three) **(15)**

1) Incorporation stage
2) Merits of Joints Stock Company
3) Notice
4) Essentials of a good business letter
5) Domicile clause of Memorandum of Association

Q. 4. State with reasons whether the following statements are True or False. (Any Three) **(15)**

1) Secretary has a power to give casting vote.
2) Signature provides legal value to the letter.
3) 21 clear days notice should be given in case of Board Meeting.
4) Fire Insurance is a contract to cover risk of loss due to sea.
5) Bank account of company opens saving account.

Q. 5. Answer in brief. (Any Two) **(10)**

1) What is Fire Insurance?
2) What are the secretarial duties after Extra Ordinary General Meeting?
3) What are primary functions of bank?
4) Explain basic principles of business correspondence.

Q. 6. Draft a notice & agenda of a Routine Board Meeting. **(10)**

OR

Explain secretarial duties in connection with statutory meeting.

OR

What is business correspondence? Explain layout of a business letter.

D.B.J. College, Chiplun

10

Std : XI (Com) | Annual Examination | Subject: Mathematics

Date: / 03/ 2019 | Time : 3 hours | Max. marks : 80

e : 1)) Figures to the right indicate full marks. 2)) All questions are compulsory. 3)) Use of calculators is not allowed.

SECTION 1

Attempt any **SIX** of the following..... (12)

1. If f(x) = x – 2 and g(x) = x^2+3x+1, then Find f_og and g_of

2. Express the complex number $\frac{i(4+3i)}{1-i}$ in the form a + bi

3. The seventh term of an A.P. is 30 and tenth term is 21, find the fourth term.

4. Express the angle 150^0 in radians.

5. Find the value of $\sin\pi^c + 2\cos\pi^c + 3\sin(3\pi/2)^c + 4\cos(3\pi/2)^c - 5\sec\pi^c - 6\operatorname{cosec}(3\pi/2)^c$

6. Find the equation of the locus of point P whose distance from Y-axis is three times its distance from origin.

7. Find equation of circle with centre (–6,4) and touching Y-axis.

8. The ages of two persons are in the ratio 7:5, ten years hence, the ratio of their ages will be 9:7. Find their ages.

A) Attempt any **TWO** of the following..... (6)

1. Prove that tan8A – tan5A – tan3A = tan8A.tan5A.tan3A

2. If the acute angle between the lines 4x – y + 7 = 0 and kx – 5y – 9 = 0 is 45^0, find the value of k.

3. Solve the equation $3x^3 - 26x^2 + 52x - 24 = 0$, if roots are in G.P.

B) Attempt any **TWO** of the following..... (8)

1. Find the value of $x^4 + 9x^3 + 35x^2 - x + 4$, if $x = -5 + \sqrt{-4}$

2. Find three numbers in G.P. such that their product is 216 and the sum of first and third is 20.

3. Find the co-ordinates of the focus, equation of directrix, length of latus rectum and co-ordinates of latus rectum for the parabola $x^2 = 16y$

A) Attempt any **TWO** of the following..... (6)

1. Find the value of x if $\begin{vmatrix} 2 & 1 & x+1 \\ -1 & 3 & -4 \\ 0 & -5 & 3 \end{vmatrix} = 0$.

2. Evaluate $\lim_{x \to 3} \frac{x^{-5} - 3^{-5}}{x^4 - 3^4}$.

3. The demand D at price P is given by $D = \frac{64}{P^3}$. Find marginal demand when price is 4.

B) Attempt any **TWO** of the following..... (8)

1. Using Cramer's rule solve the following equations x + y – z = 2, x – 2y + z = 3, 2x – y – 3z = –1.

2. Evaluate $\lim_{x \to 3} \frac{x^2 + \sqrt{x+6} - 12}{x^2 - 9}$.

3. Find derivative of $\frac{x^3 + 4x - 2}{x^2 + 2}$.

Section II

Q4. Attempt any **SIX** of the following

1. Simplify $2\log 3 - (\frac{1}{2})\log 16 + \log 12$.
2. Examine whether following data are consistent : (A) = 50, (AB) = 10, (αB) = 150, N = 120.
3. Compute third quartile for the following data 160,149,115,118,111,145,140,120,109,107,106,105,135,130,126
4. Find first two moments about zero for the set of observations – 3, – 2, 1, 3, 4.
5. For a distribution Bowley's coefficient of skewness is (– 0.8). If $Q_1 = 44.1$ and $Q_3 = 56.6$, find the median of the distribution.
6. How many 3 digit numbers can be formed from the digits 1,2,3,4,5, if the digits can be repeated?
7. A card is drawn from pack of 52 playing cards, what is the probability that the drawn card is either heart or a queen?
8. Using simple aggregate method find quantity index number :

Commodity	A	B	C	D	E
Quantity in 2005	32	40	54	80	110
Quantity in 2011	110	75	60	125	134

Q.5

A) Attempt any **TWO** of the following

1. Find the value of : $\frac{\sqrt[3]{3561}}{(2.367)^3}$
2. Find the percentage of workers who have produced less than 82 output units.

Output units produced	70-74	75-79	80-84	85-89	90-94	95-99	100-104
Number of workers	400	50	50	100	100	100	200

3. Find the value of r if ${}^{11}P_{r-1} : {}^{12}P_{r-2} = 14 : 3$

B) Attempt any **TWO** of the following

1. Calculate the mean and mean deviation about the mean for the following data :

Class	10-20	20-30	30-40	40-50	50-60	60-70
Frequency	10	70	60	40	10	10

2. The first four central moments for the variable x are 0, 26, 106 and 2298. Find first four central moments for the variable y, where $y = \frac{x - 10}{4}$
3. Obtain the coefficient of kurtosis γ_2 for the following frequency distribution :

No. of Goals	0	1	2	3	4
No. of matches	4	9	6	4	2

A) Attempt any **TWO** of the following (6)

1. Find the number of straight lines obtained by joining 10 points in a plane. if a) No three of them are collinear b) Four of them are collinear

2. Probability that a student X can solve a certain problem is $\frac{3}{4}$ and that another student Y can solve it is $\frac{4}{5}$. If both try independently, what is the probability the problem is not solved?

3. Calculate the cost of living index number

GROUP	Base year		Current year
	Price	Quantity	Price
Food	40	5	20
Clothing	30	10	35
Fuel and light	20	17	10
House rent	60	22	10
Miscellaneous	70	25	8

B) Attempt any **TWO** of the following (8)

1. If $P(A) = \frac{1}{3}$, $P(B) = \frac{1}{5}$ and $P(A \cup B) = \frac{1}{2}$ then find the values of a) $P(A' \cap B)$, b) $P(A / B)$

2. Calculate Drobish–Bowley's Price index number

Commodity	Base year		Current year	
	Price	Quantity	Price	Quantity
A	10	9	50	8
B	20	5	60	4
C	30	7	70	3
D	40	8	80	2

3. The production of steel (in million tones) in a country for years 1976 to 1986 is given in the following table. obtain trend values using 3 yearly moving averages.

Year	1976	1977	1978	1979	1980	1981	1982	1983	1984	1985	1986
Production	66.6	84.9	88.6	78	96.8	105.2	93.2	111.6	88.3	117	115.2

D. B. J. College, Chiplun

XI COMMERCE

Sub: Banking

Time: 3 Hours | **Annual Examination-2018-19** | Max. Marks: 80

Instructions : 1. All questions are compulsory.
2. Figures to the right indicate full marks.

SECTION - A

1 (A) Fill in the blanks : 5

(a) The Imperial Bank was established in the year ---------- .
(b) ---------- banks are also known as public sector banks.
(c) In case of Cheque drawer is an ---------- .
(d) A bill drawn & accepted not for consideration is known as ---------- .
(e) ---------- means additional information given after trial balance.

(B) Answer the following questions in one or two lines 5

(a) Quote any two names of commercial banks.
(b) Which is the currency of Japan?
(c) Give any two General services of the banks.
(d) What is a Trial Balance?
(e) What is a Cash Book?

2 Answer any five of the following : 10

(a) What is a contra Entry?
(b) What is mean by acceptance?
(c) What is a sales book?
(d) Explain any two agency functions of the bank?
(e) Explain State Bank of India.
(f) Explain the Debit card.
(g) Explain personal Account.
(h) What is a set of Bill?

3 Explain in brief any five of the following. 10

(a) Nationalization of the banks.
(b) Grace days
(c) What is a Balance-sheet?
(d) What is a due date?.
(e) What is material alteration?
(f) What is a Bank Reconciliation statement?
(g) Define Banking.
(h) Currency Chest

4 Define a cheque and explain in brief various kinds of cheque. 10

OR

4 Define a Bill of exchange and explain various kinds of bill of exchange. 10

5 Distinguish between Bill of exchange & Cheque. 10

OR

5 Explain the Reserve Bank of India and explain in brief its functions. 10

P.T.O.

SECTION - B

6 (A) Prepare the following documents with suitable illustrations : (Any Two) 10

1 Demand Bill of exchange

2 Order cheque

3 Promissory Note

(B) Calculate the due dates of the following. 5

1 A bill dated 31st may, 2018 payable one month after date.

2 A pro-note dated 19th Aug 2018 payable as on demand.

3 A bill dated 25th Dec, 2018 payable 70 days after date.

4 A bill dated 25th July, 2018 accepted on 31st July, 2018 payable 60 days after sight.

5. A bill dated 21 Nov, 2016 accepted on 28 Nov, 2016 payable 100 days after date.

7 From the following Trial Balance of M/s Dipak Traders, you are required to prepare Trading , Profit & Loss Account for the year ended 31st March, 2018 and Balance-Sheet as on that date. 15

Trial Balance

As on 31st March, 2015

Dr. Particulars	Amount	Cr Particulars	Amount
Opening Stock	50,000	Sales	1,90,000
Purchases	1,19,000	Return outward	1,500
Returns Inward	3,000	Discount	2,500
Wages	7,750	Sundry Creditors	52,000
Insurance	1,500	Capital	1,00,000
Salaries	9,400	Bank Loan	30,000
Rent & Taxes	5,000	Bills Payable	5,000
Bad debts	1,000		
Discount	2,000		
Machinery	25,000		
Building	55,000		
Sundry Debtors	70,000		
Advertisement	10,000		
Carriage Inward	2,350		
Cash in hand	6,000		
Cash at Bank	8,000		
Office expenses	2,000		
Drawings	4,000		
Total	**3,81,000**	**Total**	**3,81,000**

Adjustments:

1. Closing Stock was valued at Rs. 30,000/-
2. Outstanding wages Rs. 1,250/- & Rent Rs. 1,000/-.
3. Insurance was paid for a year ending 30th June, 2018.
4. Depreciate Machinery by 10 % & Building by 4%.
5. Provide R.D.D. at 5% R.D.D. on Sundry Debtors.

13

D.B.J. College (Jr.) Chiplun
Second Term Exam 2018-19
Sub : Health & Physical Education

Std. 11th Arts & Science | Supervisor Sign :_____

Time : 1 hrs. | Div. _____ | Roll No. _____ | Marks : 25

Note: 1) All questions are compulsory (सर्व प्रश्न अनिवार्य आहेत.)
2) Figure to the right indicate marks. (उजव्या बाजुचे अंक गुण दर्शवितात.)

Q.1 **Choose the correct alternatives and fill in the blanks.** 5

11- 5, , Gold Medal, Silver medal, Rajvardhan Rathod, Vinod Tawade, Warming up, 29th August, 29 September, Indonesia, Chine, 7-5, (११- ५, २९ ऑगस्ट, राजवर्धन राठोड, विनोद तावडे, २९ सप्टेंबर, इंडोनेशिया, चीन, ७-५. सुवर्ण पदक, रजत पदक)

1 ..... is the sports Minister of India.
भारताचे क्रीडा मंत्री ..... आहेत.

2 In 2018 Asian game Indian women kabaddi team win ..... medal.
सन २०१८ मध्ये एशिन स्पर्धेत महिला कबड्डी मध्ये भारतीय संघाला .....पदक मिळाले.

3 In Criket team ..... Number of player are in and ..... are reserved players.
क्रिकेट खेळाच्या संघात प्रत्यक्ष खेळणारे ..... खेळाडू व ..... राखीव खेळाडू असतात

4 ..... is the national sports day of India.
..... हा दिवस भारताच्या राष्ट्रीय क्रीडा दिन आहे.

5 Asian games were held at ..... in 2018
२०१८ साली ..... येथे एशिन स्पर्धा झाली.

Q.2 **Match the following** 5

	A	Answer	B
1	Tenjindrapal Sing Toor तेजंद्रपाल सिंग तोर	_____ _____	1) Running धावणे
2	Sushil Kumar सुशिल कुमार	_____ _____	2) Badminton बॅडमिंटन
3	Vinesh Phogat विनेश पोघाट	_____ _____	3) Boxing बॉक्सिंग
4	Hima Das हिमा दास	_____ _____	4) Wrestling कुस्ती
5	Sayana Nehval सायना नेहवाल	_____ _____	5) Shout put गोळा फेक

Q.3 **Write a short note.** 5

1 Impotents of diet . (आहाराचे महत्व)

Q.4 Explain in details any national / international game (ground etc.)
कोणत्याही एका राष्ट्रीय किंवा आंतरराष्ट्रीय खेळाचा प्रकल्प (मैदानासहित) तयार करा.

14

D.B. J. College , Chiplun
Annual examination March 2019
Sub.- Economics
Std.- 11th Commerce
Date -

Time – 3 hrs. Marks – 80

Note – 1. All questions are compulsory.
2. Figures to the right indicate full marks.
3. Draw tables and diagrams on same answer sheet . No separate graph paper will be provided.

Q. 1.A. Choose correct alternative and rewrite the statement. 5

1. Unemployment during off season is called as ..... unemployment.
(urban , industrial , educated , seasonal)
2. Physical Quality of Life Index is developed by .....
(UNDP , Morris D. Morris , Amartya Sen , Mehabub- Ul -Haq)
3. Index number of base year is .....
(0 , 10 , 100 , 1000)
4. Median of the given series 2 , 4 , 6, 5, 1, 0, 8, is .....
(5, 2, 8, 4)
5. In India railway transport was introduced in .....
(1853, 1920, 1947, 1951)

B. Match the following. 5

A	B
1. Year of great divide	a. L – S
2. First five year plan	b. Maximum frequency
3. Air transport	c. 1921
4. Mode	d. 1951 – 1956
5. Range	e. Fastest mode of transport
	f. Middle most observation
	g. 1991

C. State whether following statements are true or false . 6

1. There is no relative poverty in U. S. A.
2. In India radio was introduced in 1935.
3. Privatization means increasing size of Public sector.
4. Internet is source of primary data.
5. Decile divides data in 10 equal parts.
6. Index number is economic barometer.

Q. 2.A. Define or explain the following concepts. (any 3) 6

1. Density of population
2. Economic Planning
3. Liberalization
4. Absolute poverty
5. Statistics
6. Index number

B. Give reasons or explain. (any 3) 6

1. There is difference between concept of economic development and economic growth.
2. Frictional unemployment is temporary.
3. There are some negative effects of new economic policy on agriculture sector.
4. There are certain problems of energy sector in India.
5. Statistics is useful to policy makers in government and business organizations .
6. Selection of base year is a difficult task.

Q.3.A. Distinguish between the following .(any 3) 6

1. Voluntary unemployment and involuntary unemployment
2. Working population and non- working population
3. Railway transport and road transport
4. Mean and Median
5. Primary data and secondary data
6. Census survey and sample survey

P.T.O.

B. Write note on the following (any 2) 6

1. Human Development Index
2. Measures towards liberalization
3. Water transport
4. Types of table

Q.4. Answer the following questions . (any 3) 12

1. What are effects of population explosion ?
2. Explain various effects of new economic policy on service sector.
3. Explain renewable sources of energy.

4. Draw multiple bar diagram for following data .

Factory	A	B	C	D
Males:	2000	1800	2200	1500
Females:	1000	1600	2000	1000

5. Calculate arithmetic mean for following data.

X :	0 – 100	100 – 200	200 – 300	300 – 400	400 - 500
F :	2	3	4	3	3

6. Draw histogram for following data

Marks :	0 – 10	10 – 20	20 – 30	30 – 40	40 – 50
Students:	5	10	20	15	5

Q. 5. Do you agree with following statements? Give reasons. (any 3) 12

1. Government has not undertaken any measures to reduce poverty.
2. There are no effects of unemployment.
3. Economic crisis of 1991 necessitated economic reforms in 1991.
4. Health sector has recorded remarkable progress.
5. Transport plays important role for economic development .
6. There are various sources of secondary data.

Q.6. Answer in detail. (any 2) 16

1. What are causes of high birth rate in India ?
2. Describe various means of communication used in India.
3. Explain various economic reforms introduced after 1991
4. calculate mode and median for following data

X :	0 – 10	10 – 20	20 – 30	30 – 40	40 – 50
F:	2	8	10	5	5

.....XOXOXOXOXO.....

D.B.J.College, Chiplun

Annual Examination 2018-19

Sub: - Book-keeping & Accountancy

Class: - XI Com A,B,C,D.

- 3Hrs

Marks:-80

Attempt **Any Three** sub-questions.

Answer in one sentence only. (15)

1. State the meaning of Error of principle? (05)
2. Which account is depreciation amount is transferred?
3. What is Bank Overdraft?
4. What balance does capital A/C show?
5. What is Capital?

Write the word/term/phrase which can substitute each of the following statement. (05)

1. Type of an asset on which depreciation is provided.
2. Statement showing financial position of business.
3. Mention the side where goodwill A/C is appeared in the Trial Balance.
4. Refusal by bank to make the payment of Cheque.
5. Error of calculation.

Select the most appropriate alternative from those given below & rewrite the statements. (05)

1. Bank reconciliation statement is prepared by_____.
   a) Trader b) Bank c) Seller d) students.
2. Drawings account appears in _____ of the trial balance
   a) LF b) debit side c) credit side d) none of these.
3. Rectification entries are passed in _____
   a) Ledger b)Balance Sheet c) cash book d) journal proper
4. Depreciation = $\frac{\text{Cost of asset - ----------}}{\text{Estimated working life of an asset.}}$
   a) Installation charges b) cost price c) Scrap value d) Selling price
5. Outstanding expenses is a _____ account.
   a) Real b) Personal c) Nominal d) None of them.

State whether the following statements are True or False. (05)

1. All the errors can be rectified only through suspense account.
2. Depreciation is a non-cash expense.
3. Trial balance is prepared from the balance of ledger account.
4. Capital Account is a real account.
5. Computer accounting system is used for recording the financial transaction.

Classification of account into Assets, liabilities, Expenses and Income. (05)

a) Goodwill A/C b) Bank Loan A/C c) Carriage A/c d) Royalty A/C
e) Patents A/C f) Interest on Drawings A/C g) Outstanding Salary A/C h) Repairs A/C
i) Dividend received A/C j) Capital A/C

Prepare trial balance as on 31st Mar 2010 from the ledger of Shri. Ganesh. (08)

Particulars	Amount	Particulars	Amount
Capital	50,000	Salary	4,500
Debtors	2,500	Sales	40,000
Wages	3,500	Postage	250
Depreciation	1,500	Creditors	4,000
Furniture	12,500	Land & Building	45,000
Advertisements	2,500	Bank Loan	2,000
Bad Debts	600	Cash in hand	1,250
Carriage	2,500	Rent	2,900
Purchases	15,000	Drawings	1,500
Commission received.	2,000	Bills payable	2,000

OR

A. **Explain importance of computerized Accounting system.** (04)

B. **Explain the limitations of computerized Accounting system.** (04)

On 1st April 2006 Nishant & Co. purchased a Machinery for Rs. 2, 00,000 . On 1st October in the same year new Machinery was purchased for Rs.1,00,000. (10)

On 1st October 2007 the machinery Purchased on 1st April 2006 was sold for Rs.90, 000. On 1st October 2008 additional new Machinery was purchased for Rs.2, 50, 000.

The firm provides depreciation on Machinery @10% under Straight Line method on 31st March every year.

Show Machinery Account, and depreciation Account for 3 years ending up to 31st March 2009.

Q.4: Rectify the following errors, use suspense A/C wherever necessary.

1. Purchased Machinery of Rs.25, 000/- from Jayashri Traders was wrongly Recorded in Purchase book.
2. Extension to building of Rs 9, 500/- was debited to repairs account.
3. Received Rs. 825 from Suraj wrongly debited to Suresh account.
4. Total of return outward book was undercaste by Rs. 410.
5. Goods purchased from Manisha for Rs.800/- was passed through sales book.

Q.5: From the following information provided by Mr.Kamble prepare his Bank Reconciliation statement as on 31st March 2011.

i) Bank overdraft as per the pass book Rs.16,500/-
ii) Cheques issued to the suppliers but not presented to the Bank Rs.8,750/-
iii) Cheques deposited with the Bank but not credited by Bank Rs.10,500/-
iv) Cheque issued recorded in the cash book but not sent to the Bank for collection Rs.2,00(the party.
v) Customer directly deposited in to the Bank A/C Rs.3,500/-.
vi) Pass Book shows debit entry for Bank Charges Rs.200/-.
vii) As per standing advice to the Bank, Bank paid Insurance premium Rs.1980/-.
viii) A Bill of exchange for Rs.3,000/- discounted with Bank in February, 2011 dishonored in M 2011 and not recorded in cash book.

Q.6: Journalize the following transactions in the book of Kapadia & Company for the month of 2012. Balance as on 1st April, 2012.

Cash at Bank Rs.1,00,000/-, Land & Building Rs. 1,80,000/-, Laptop and Printer Rs.60,000/- Debtors-Zinit Rs.5,000/- & Yamini Rs.4,000/-,Bank Loan Rs.28,000, Creditors – Mohini Rs. 6,00 Nitin Rs.9,000/-.

April 2012-
2. Purchase goods of the list price Rs.20,000/- at 10% trade discount on credi Mr.Ojas.
4. Received Rs.3,700/- cash from Yamini in full and final settlement of her accou
6. Goods costing Rs.900/- destroyed by fire.
9. Sold goods to Mr.Vaman on credit Rs.10,000/-.
11. Cash withdrawn by proprietor for personal use Rs.4,000/-.
14. Mr.Vaman paid Rs.9,000/- after getting 10% cash discount for prompt payme
21. Paid Rs.8,900/- to Nitin in full and final settlement of his account.
30. Cash sales at list price Rs.8,000/-, trade discount allowed Rs.400/-

Q.7: From the following Trial Balance of Mr.Rohit Zende, prepare Trading and Profit & Loss Ac for the year ended 31st March 2007 and Balance sheet as on that date.

Trial Balance as on 31st March, 2007

Particulars	Amount Rs.	Particulars	Amount Rs.
Opening Stock	10,000	Creditors	25,000
Purchase	60,000	Bank Loan	30,000
Wages	7,000	Sales	1,22,000
Carriage	2,500	Reserve for Doubtful debts	700
Salaries	4,500	Capital	45,000
Advertisement	1,000	Commission	5,000
Bad Debts	2,000		
Discount Allowed	3,500		
Debtors	16,000		
Bills Receivable	12,000		
Buildings	30,000		
Machinery	40,000		
Cash in hand	8,400		
Leasehold Premises	20,000		
Drawings	4,800		
	2,27,700		**2,27,700**

Adjustment:-

1) Cost price of closing stock was Rs.21,000/- while its market price was Rs.24,000/-.
2) Outstanding expenses were salary Rs. 500/-, Wages Rs.600/-, and Interest on Bank loan Rs.2,00
3) Reserve for doubtful debts is to be maintained at 5% on debtors.
4) Sales included Rs.2,000/- sales of old news paper.
5) Leasehold premises is to be run for 10 years.
6) Depreciation on Building Rs.2,000/- and Machinery Rs.4,000/-.

D.B.J.College; Chiplun

(1) 16

Anuual Exam - March 2019

Std:- XI Commerce | Sub:- English | Marks:- 80 | Time:- 3 Hours

SECTION - I

(Reading Skill, Grammar, Vocabulary, Note-making and Summary)

Q.1 (A) Read the first activity, read the extract and do all the activities that follow: [15] (12)

A1. Complete - (2)

Complete the following statement by choosing two correct reasons from the options given below:

To hold conversation with Kim was difficult because_____ and _____

i) he was overexcited to speak.

ii) his mind shifted quickly from one topic to another .

iii) he was not interested in the conversation.

iv) he needed somebody's help to steer him back to the original topic.

The Oscar-winning role played by Dustin Hoffman in 1988 film, about an autistic savant with astounding arithmetical skills, is indeed based on Kim Peek (among others), although Kim is not autistic but developmentally disabled. Most savant possess remarkable expertise in up to three subjects. Kim is a mega-savant, because he is expert in at least 15 different subjects. No one in the world is thought to possess a brain as extraordinary as Kim Peek's. NASA is hoping to use modern advances in brain imaging and data fusion techniques to shed light on how Kim's brain ticks.

I ask Kim what he feels about it. "It's the best way of all, " he replies enigmatically. Why does he think he knows so much?" I have great love for everybody I see," he answers. It is hard to hold a conversation with Kim. His mind flits from one subject to the next with bewildering rapidity - with Fran always trying to steer Kim back on course.

I tell them I grew up near a town called Cirencester. "It was a Roman Camp, called Corin," says Kim. "Corinium," I correct him. Later I check and find that he is right: the Romans based the name Corinium on the Celtic word Corin.

When Kim was born in 1951, his head was a third larger than normal, with an encephalocele - a blister into which part of his brain protruded - across the back of his head. At the age of three the blister retracted, pulling a nodule into Kim's cerebellum, destroying most of it. In 1983 he had an x-ray which showed that he had one solid brain hemisphere, instead of two. A leter scan showed that the right half of Kim's cerebellum had exploded into three pieces.

A2 Order -

Following sentences summarize the paragraphs but they are jumbled up, arrange them in the order of their occurrence. (2)

i) He had a photographic memory.

ii) Though physically challenged, Kim possessed unusual abilities,

iii) At the time of his birth his head had some abnormalities.

iv) He could flawlessly give the details of any information he knew, which amazed the scientists.

(2)

A3 Guess -

Mention any two difficulties Kim would have to face in his life. (2)

A4 Vocabulary -

Find and write four describing words from the extract which are similar in meaning to the word 'amazing'.

A5 Personal Response:

Expalain the role of a genius person in human progress. (2)

A6 Grammer -

(Do as dircted)

i) No one in the world is thought to possess a brain as extraordinary as Kim Peek's (Rewrite the sente... in superlative degree.)

ii) NASA is hoping to use modern advances in brain imaging and data fusion techniques to shed light o... how Kim's brain ticks. (Rewrite using 'not only ------- but also'.) (3)

B Grammar -

Do as dircted:

i) My father is ..... M.A., he is ..... teacher.

(Fill in the blanks using appropriate articles)

ii) Yesterday I went ..... the gateway of India ..... my family.

(Fill in the blanks with proper prepositions)

iii) My sister said to me, "Do you like English? [Change the narration]

Q. 2 (A) Read the first activity, read the extract and then do all the activities: [15]

(12)

A1 Table -

Complete the table with the information from the passae: (2)

Village	Meaning	Home to
Morachi Chincholi	---------- ----------	---------- ----------

The highway from Pune to Ahmednagar is an interesting one. Farmers in traditional white peaked caps zip past you, some in fancy new cars. Signs of prosperity are apparent, although the region battled with severe drught just a couple of years ago. A few kilometers down the highway, beyound the small town of Chikrapur, a left turn reveals the road that leads to our destination- the village of Chincholi Morachi. Loosely translated, it means the abode of peacocks and tamarind trees, both of which are in abundance here. For, this quaint little village, almost 60km from Pune, is home to a population of 2,000 people, as well as an equal number of peacocks.

As you interact with people here, it's quite evident why the national bird enjoys special status at chincholi Morachi. In this village, the peacock is not just protected, but also revered - so much so that this is one place where its numbers have steadily increased over the years. "Ten years ago, there were almost 600 peacocks in our village. Now, the number is more than three times," says Maheshrao Gorde, the village sarpanch. For most of the villagers, the peacock is not just a bird, it is also a symbol associated with the village deity Khandoba. "The peacock is the vahan(vehicle) of Khandoba, and is therefore special for us," says Gorde Perhaps it's a reflection of this special relationship that even when the region was reeling under drought and there was not a drop of water to drink, the villagers ensured that there was still some availbale for the peacocks, recalls S.H.Phalke, who teaches at the local agricultral institute. Most people here treat peacocks like their children," he adds. "Which is why you'll find that during sowing time, extra grain is planted in the fields so that the peacocks too can have their fill."

No one in the village remembers if ever a peacock was harmed in Chincholi Morachi. The only instance that a few villagers can recall happened almost 25-30 years ago, when a boy from a neighbouring village, who had come as part of a marriage party, threw a stone at a peacock and injured it. The peacock died soon after. The incensed villagers filed a case with the district administration against the boy's family. Only when the family apologized saying that the boy was a minor, were matters sorted out, says P.S.Gawade, the principal of the local school.

A2. Complete the following statements. 17 (2)

i) The numbers of peacocks starting increased over the year here because.....

ii) Extra grain is planted in the fields because .....

A3. Find Out -

'The incensed villagers filed a case wih the district administratiion against the boy's familly.'

Find out such an incident from the passage to prove this statement. (2)

A4. Vocabulary:

Find the words from the passage for: (2)

i) the place where one lives

ii) respected

iii) moving unsteadily

iv) upset with

A5. Personal Response: (2)

What do you learn from the villagers of 'Chincholi?'

A6. Grammar: (2)

Rewrite the following Sentences in the ways instructed:

i) Most people here treat peacocks like there children. (Change the voice.)

ii) The incensed villagers filed a case with the district administration against the boy's fimily.

(Frame 'Wh-question' to get underlinned part of the sentence as answer.)

(B) Note - Making: (3)

Read the following extract and complete the note given below:

Roughly eight million tons of plastic enters the ocean every year. That's according to a 2015 report, which also identified where the bulk of this trash originates. At the top of the list: China, the Philippines and Indonesia.

Sightings of junk-filled waters are common - and not only in southeast Asia, says marine biologist Nicholas Mallos, who runs the Ocean Conservancy's Trash Free Seas program. "Accumulations like this are unfortunately the norm," he says, particularly in developing parts of the world where there are "rising middle class populations among coastlines, and spending and consumptions have increased, but waste management has not."

Though trash remains a global problem, Mallos sees reasons to be hopeful. In the United States, for example, California voters in 2016 upheld a statewide ban on plastic bags. And in Indonesia he says, there has been a shift in awareness: "We are seeing an eager and willing group of stakeholders who are trying to step up and tackle these issues."Put another way: The tide may be turning.

Garbage Swell

a] Bulk of trash originates from _____

b] Marine biologist, Nicholas Mallos, runs the _____

c] Causes for polluting seas: i) _____

ii) _____

d) Hopeful efforts to resolve the pollution: i) _____

ii) _____

Q. 3 (A) Read the first activity, read the extract and do the activities that follow. [15]

(12)

A1 Complete : (2)

Complete the following statement by choosing two correct reasons from the options given below.

Rural people are migrating to urban areas because.....

i) They want to meet their relatives living in city.

ii) Employment opportunities are available in city area.

iii) They want to lead only luxurious life.

iv) Educational facilities are present in city area.

People on large scale are migrating to urban areas in search of employment. There is less scope employment in rural areas, but in urban areas, there is a vast scope for employment in industries, tra transport. People want to settle in cities for the higher education of their children. Emergence of IT sector lead to migration of working class.

Number of poor in urban areas are increasing rapidly. But only skilled persons in urban areas having good living standard. Unskilled labourers are in the worst condition. They may not have regular jobs, employed workers have to change their job to find a new one.

In city area, many poor live in slum area. They have no good houses to live in. The areas in which th live are not having well sanitation facilities. Though, the sanitation is not proper in rural areas, it has vast spa to help dispose waste properly.

The rural poor have large space to live in, while the urban poor have to live only in small houses. urban areas no proper light and air is availbale in houses. Density is more in urban area in comparison to ru areas. unhealthy housing is the burning problem of urban poor.

Rural poors enjoy clean atomosphere in their natural environment. But urban poors have to fa pollution problems. Air, water and soil are polluted in urban areas. The noise pollution is one more serio problem for urban poor.

Health of urban poor is always at risk. They have to face epidemics like dangue, malaria, cholera etc.

Social problems of rural poor are not as grave as urban poor. Urban poor have many ill-habits lik alcoholism, drug addiction, gambling, etc. More work and less rest, no social atmosphere, feeling of beir backward etc. can make urban poors mentally disturbed. Their mental health is always at risk as their life is fu of stress and strain.

Thus, it seems that rural poors are having better life than urban poors.

A2 True or False - (2)

State whether the following statements are true or false.

i) Rural areas have no sanitation problems.

ii) Urban poor face many social problems.

iii) Urban poor lead better life than rural poors.

iv) Rural poor enjoy natural and healthy life.

A3 Conclusion - (2)

It seems that rural poors are having better life than urban poors.

The sentence implies the life of rural poors..... (Complete it in a paragraph)

A4 Match the words in column 'A' with their meanings in column 'B'. (2)

Column 'A'	Column 'B'
a) sanitation	i) tightness
b) density	ii) infestation
c) epidemics	iii) bet
d) gambling	iv) hygiene or healthiness

A5 Personal response: (2)

Write a paragraph on your important suggestions to handle Rural to Urban Migration.

A6 Grammar: (2) 18

Do as directed.

i) The urban poor 'have to' live only in small houses (choose the correct answer.)

The word 'have to' indicates

(a) ability (b) permission (c)compulsion

ii) Choose the correct alternative which expresses that past perfect tense form of the given sentence:

In city area many poor live in slum area.

(a) In city area many poor will live in slum area.

(b) In city area many poor lived in slum area.

(c) In city area many poor had lived in slum area.

(d) In city area many poor have lived in slum area.

Q.3 (B) Summary:

Write a brief summary of the above extract with the help of the points given below and suggest a suitable title. **(3)**

Migration.....employment.....and.....education.....housesand sanitation.....Density.....pollutions..... health & social problems.....life styles.

SECTION - II

(Poetry)

Q.4 Read the following extract and then do all the activities that follow. **(8)**

My Mother

When the stars go off
Tall chimney-sirens sound
Daily with fast steps
Marching to the mill
Who looked backwards
And told us so lovingly
"Do not fight with anyone."
Gave us two paise
On the day before Dasara
She went with five of us
To see the festival
We bantered in the lanes
What a great pleasure
Beyound words
We returned with ballons
And whistles and pipes
We became birds.

A.1 Complete the web by listing things that express great pleasure of children. **(2)**

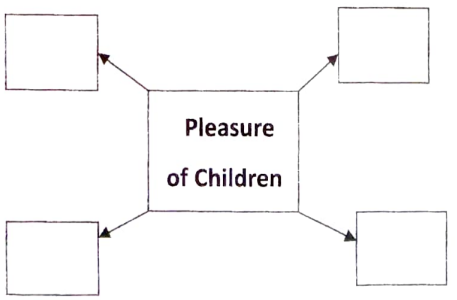

A.2 Poetic Devices:

"We became birds"

Name and explain the figure of speech in the above line (2)

A.3 Personal Response-

Do you think that children live with comfort without thier mother? If not, what problems do they face in that situation? (2)

A.4 Poeting Creation:

Compose two poetic lines about importance of mother in your life. (2)

SECTION - III

(Rapid Reading & Composition)

Q.5 (A) Read the following extract and do the activities that follow it. (4)

All the next day he sat on the Prince's shoulder, and told him stories of what he had seen in strange lands. He told him of the red ibises, who stand in long rows on the banks of the Nile, and catch goldfish in their beaks; of the Sphinx, who is as old as the world itself , and lives in the desert, and knows evrything; of the merchants, who walk slowly by the side of their camels and carry, amber beads in their hands; of he King of the Mountains of the Moon, who is as black as ebony, and worships a large crystal; of the great green snake that sleeps in a palm -tree, and has twenty priests to feed it with honey-cakes ; and of the pygmies who sail over a big lake on large flat leaves, and are always at war with the butterflies.

" Dear little Swallow,"said the Prince, "you tell me of marvelous things, but more marvelous than anything is the suffering of men and of women. There is no Mystery so great as Misery. Fly over my city, little Swallow, and tell me what you see there."

So the Swallow flew over the great city and saw the rich making merry in their beautiful houses, while the beggars were sitting at the gates . He flew into dark lanes, and saw the white faces of starving children looking out listlessly at the black streets. Under the archway of a bridge two little boys were lying in one another's arms to try to keep themselves warm. "How hungry we are!"they said. "You must not lie here," shouted the watchman, and they wandered out into the rain.

A.1 True/False-

State whether the following statements are true or false. (2)

(i) All the next day he sat on the Prince's shoulder

(ii) And has twenty priests to feed it.

(iii) There is mystery so great as misery.

(iv) They wondered out into the forest.

A.2 Write an imaginary ending:

Write an imaginary paragraph in about 50 words to give different ending to the above extract. **(2)**

(B) Read the following extract and do the activities that follow it. (4)

When Della reached home her intoxication gave way a little to prudence and reason. She got out her curling irons and lighted the gas and went to work repairing the ravages made by generosity added to love. Which is always a tremendous task, dear friends-a mammoth task.

Within forty minutes her head was covered with tiny, closelying curls that made her look wonderfully like a truant schoolboy. She looked at her reflection in the mirror long, carefully and critically.

"If Jim doesn't kill me," she said to herself, " before he takes a second look at me, he"ll say I look like a Coney Island chorus girl. But what could I do-oh what could I do with a dollar and eighty-seven cents?"

At seven o'clock the coffee was made and the frying-pan was on the back of the stove, hot and ready to cook the chops.

Jim was never late. Della doubled the fob chain in her hand and sat on the corner of the table near the door that he always entered. Then she heard his step on the stair away down on the first flight, and she turned white for just a moment. She had a habit of saying little silent prayers about the simplest everyday things, and now she whispered. "Please God, make him think I am still pretty."

The door opened and Jim stepped in and closed it. He looked thin and very serious. Poor fellow, he was only twenty two and to burdened with a family! He needed a new overcoat and he was without gloves.

Jim stepped inside the door, as immovable as a setter at the cent of quail. His eyes were fixed upon Della, and there was an expression in them that she could not read, and it terrified her. It was not anger, nor surprise, nor disapproval, nor horror, not any of the sentiments that she had been prepared for. He simply stared at her fixedly with that peculiar expression on his face.

B1. Complete the following - **(2)**

I. Della had cut off her hair because:

i) .....

ii) .....

II. Extend the above extract by adding your own imaginative paragraph in about 50 words.

B2. Convert the above extract into a dialogue between Jim and Della. **(2)**

SECTION IV

(Written Communication)

Q.6 (A) Letter Writing: **[12]**

Write any ONE of the following letters:

(1) Read the following advertisement and prepare a letter of application in response to it, using the information given in the C.V. that follows: **(4)**

Situation Vacant
Sales Representatives **Young male/female, Commerce** graduate, computer literate with 1-2 years experience, fluent in English and Marathi **Apply to :** Box A-111 Times of India Mumbai-400 001

CV (Curriculum Vitae)	
Name	: Arun/Aruna Patil
Address	: 8 B, Ekata Apartment, M.G Raod, Damodarnagar, Pune - 411 058
Age	: 25 years
Nationality	: Indian
Experience	: Working as a sales Representative at Ganesh sales Agency Pune.
Academic Achievements.	

Sr.No.	Exam Passed	University /Board	Year of Passing	Percentage
1)	B.Com	Pune	March 2010	72%
2)	MS-CIT	MKCL	March 2012	85%

OR

(2) Read the following intro of a news, write to the commissioner requesting for urgent action.

Overflow of Drainage for a week

Mumbai 12, Majority drainages are overflowing in Dadar area, bringing health hazands for the citizens. Lack of clenaliness has resulted into an unhygienic condition. The Municipal Commissioner needs to look into the matter and take firm action at the earliest before it becomes grave problem.

(4)

(B) Write on any ONE of the following items:

(1) Write a short tourist leaflet on any tourist station you know with the help of the following points.

(i)How to reach there? (ii)Where to stay

(iii)What to see? (iv)Shopping attractions

(v) Add your own points.

OR

(2) Report Writing:

Write a report on the 'Tree-Plantation Programme' by the N.S.S unit of your college on 15th August.

(C) Write on any ONE of the following items: **(4)**

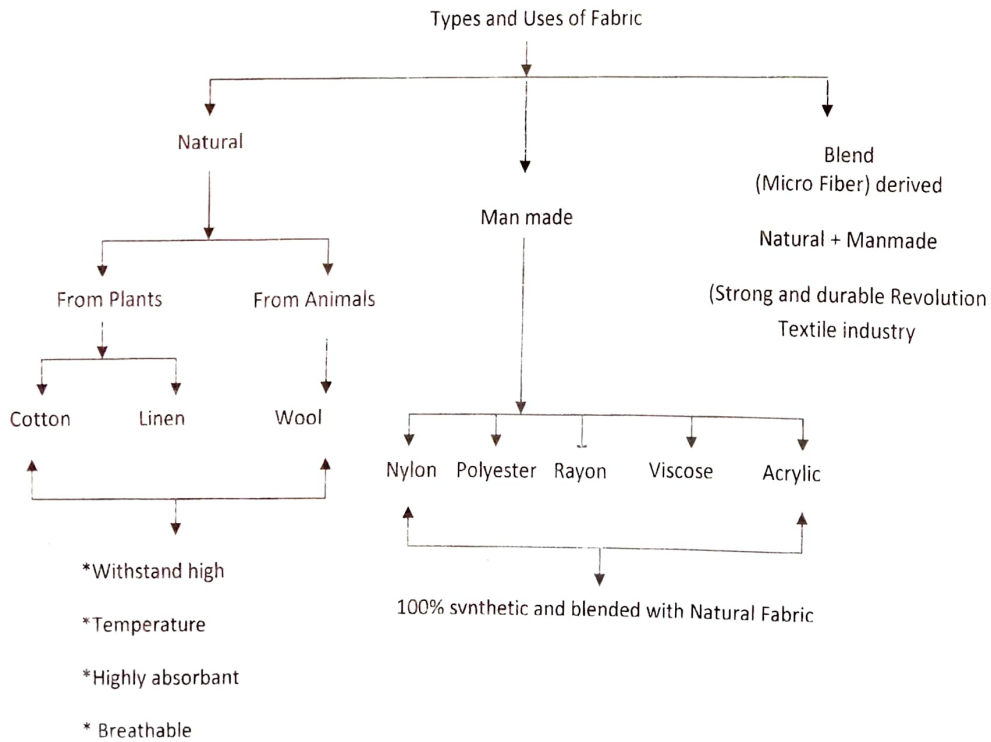

1) Study carefully the above given tree diagram about 'Types and uses of Fabric' and write a short paragraph based on it in about 120 words.

(4)

OR

20

2) Prepare a paragraph with an appropriate title to be used for the counter-view section on the following topic in about 120 words. (4)

View- Section: Science- a boon to mankind.

- has made life comforatble and happy
- has made revolution in the field of agriculture, medicine & space research.
- communication and transport brought the world closer.
- helpful in the field of education.

Q.7 Do the following activities: [7]

(A) Imagine you are going to interview a well known doctor in your area. Prepare a set of 8 to 10 questions focusing on his career, practice, social behaviour and the activities he carries out. Frame one introductory question, some probing questions and one concluding question. (4)

(B) Prepare a speech on 'The World Earth Day' in about 100 words with the help of the following points: (3)

i) Importance of the day

ii) Adverse effect of various pollutions

iii) Loss of natural resources

iv) Live in harmony with nature.

D.B.J. College Chiplun
Annual Exam – 2018-19
Std -XICom (A,B,C,D)

Time: 3:00 Hrs | Subject – Organization of Commerce & Management | Marks - 80

Note:- 1)All questions are Compulsory.
2) Figures to the right indicate full marks for the questions.
3) Figures to the left indicate question number.
4) Answer to every question should start on a new page.

Q.1) A)Select the proper option from the options given below and rewrite the Sentences. **(05)**

1) For customs clearance, the _____ is prepared by the exporter.
a) Carting Order b) Letter of Origin c) Shipping Bill

2) A change in the ruling government is an aspect of _____ environment.
a) Economic b) Social c) Political

3) _____ is a basis of marketing function.
a) Seller b) Customer c) Agent

4) To look after maintenance of machinery is the function of _____ level of management.
a) Top b) middle c) lower

5) ____ is one of the modes of entry which requires high level of risks.
a) Licensing b) Franchising c) Joint venture

B) Match the pairs. **(05)**

'A' Group	'B' Group
A) Airway bill	1) When goods are sent by air
B) Internal Environment	2) Quality checking body
C) Durable product	3) Machinery
D) Top level management	4) When goods are sent by road
E) WTO	5) Designs rules of international trade
	6) Directing subordinates to complete the task
	7) Foreign policy
	8) Policy framing
	9) Controllable factors
	10) Vegetables

C) Write a word or a phrase or a term, which can substitute each of the following statements. **(05)**

1) A type of trade that sells the goods directly to ultimate consumer.
2) Guarantee given by the banker of the importer that it will release the payment upon receiving the goods.
3) The environment of business that includes customs and traditions, values & social trends.
4) A place where buyers and sellers come together for buying and selling.
5) Systematic body of knowledge.

Q. 2. Distinguish between the following (AnyThree) **(15)**

1) Business and Employment
2) Domestic Business and International Business
3) Globalization and Liberalization
4) Selling and Marketing
5) Top level Management and Middle level Management

Q. 3. Write short notes on the following (Any Three) **(15)**

1) Management as a profession
2) Marketing mix
3) Need of privatization
4) Joint venture
5) Features of government company

Q. 4. State with reasons whether the following statements are true or false. (Any Three) **(15)**

1) Transport creates place utility.
2) Bill of entry is not part of export documents.
3) Social environment consist of factors related to the management of public affairs.
4) The standard of a product or service can be decided by price.
5) Lower level management is engaged in policy making.

Q. 5. Write short Answers (Any Two) **(10)**

1) State the features of management in brief.
2) What are the types of channel of distribution?
3) What is need and importance of business environment?
4) What are the advantages and disadvantages of direct and indirect exports?

Q. 6. What is advertising? Explain its importance. **(10)**

OR

Explain the levels of management and discuss their functions.